Finden der fehlenden Seitenlänge des Rechtecks Name:

Finden Sie den Wert von X für jede Figur. Jede Zahl ist in Zentimetern (cm) angegeben. Nicht maßstabsgetreu.

1) area = 56 cm^2

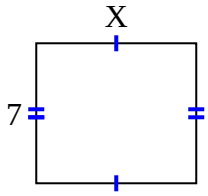

2) area = 36 cm^2

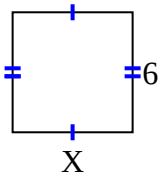

3) area = 32 cm^2

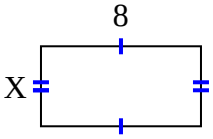

4) area = 72 cm^2

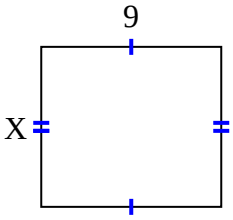

5) area = 12 cm^2

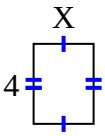

6) area = 63 cm^2

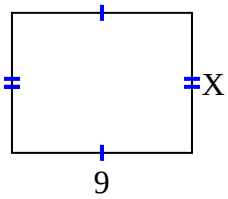

7) area = 18 cm^2

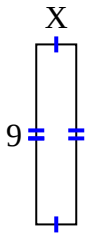

8) area = 40 cm^2

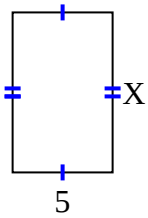

9) area = 18 cm^2

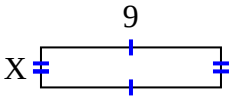

10) area = 30 cm^2

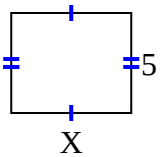

11) area = 15 cm^2

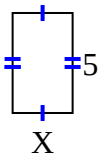

12) area = 15 cm^2

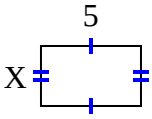

13) area = 45 cm^2

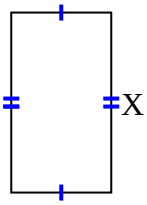

14) area = 72 cm^2

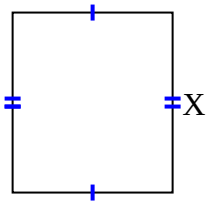

15) area = 16 cm^2

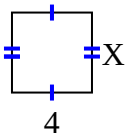

Antworten

1. _____
2. _____
3. _____
4. _____
5. _____
6. _____
7. _____
8. _____
9. _____
10. _____
11. _____
12. _____
13. _____
14. _____
15. _____

1-10	93	87	80	73	67	60	53	47	40	33
11-15	27	20	13	7	0					

Finden der fehlenden Seitenlänge des Rechtecks Name: **Lösungsschlüssel**

Finden Sie den Wert von X für jede Figur. Jede Zahl ist in Zentimetern (cm) angegeben. Nicht maßstabsgetreu.

1) area = 56 cm^2

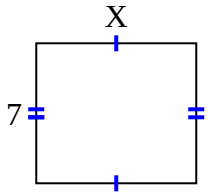

2) area = 36 cm^2

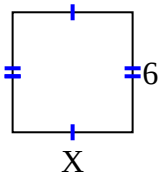

3) area = 32 cm^2

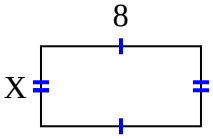

4) area = 72 cm^2

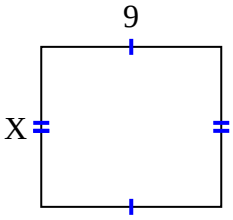

5) area = 12 cm^2

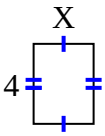

6) area = 63 cm^2

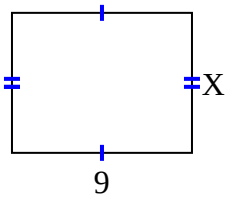

7) area = 18 cm^2

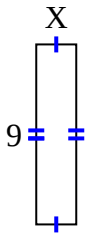

8) area = 40 cm^2

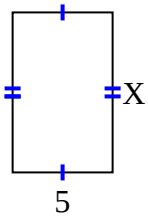

9) area = 18 cm^2

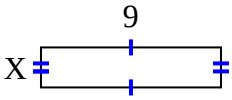

10) area = 30 cm^2

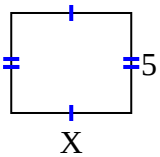

11) area = 15 cm^2

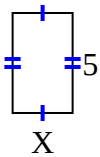

12) area = 15 cm^2

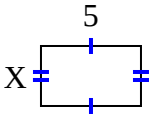

13) area = 45 cm^2

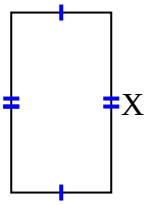

14) area = 72 cm^2

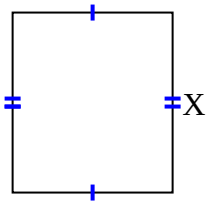

15) area = 16 cm^2

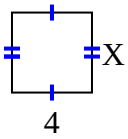

Antworten

1. 8
2. 6
3. 4
4. 8
5. 3
6. 7
7. 2
8. 8
9. 2
10. 6
11. 3
12. 3
13. 9
14. 9
15. 4

1-10	93	87	80	73	67	60	53	47	40	33
11-15	27	20	13	7	0					