Umwandeln von Multiplikationsaufgaben

Name:

Schreibe jede Anordnung als eine Multiplikationsaufgabe um und löse sie.

Bsp)

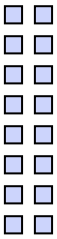

1)



2)

3)



4)

5)



6)

7)



8)



9)

10)



11)



Antworten

Bsp. 8 • 2 = 16

1. _____
2. _____
3. _____
4. _____
5. _____
6. _____
7. _____
8. _____
9. _____
10. _____
11. _____

Umwandeln von Multiplikationsaufgaben Name: **Lösungsschlüssel**

Schreibe jede Anordnung als eine Multiplikationsaufgabe um und löse sie.

Bsp)

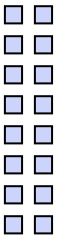

1)



2)

3)



4)

5)



6)

7)



8)



9)

10)



11)



Antworten

Bsp. **8 • 2 = 16**

1. **7 • 5 = 35**
2. **4 • 6 = 24**
3. **8 • 4 = 32**
4. **3 • 6 = 18**
5. **7 • 8 = 56**
6. **6 • 2 = 12**
7. **10 • 10 = 100**
8. **9 • 10 = 90**
9. **3 • 5 = 15**
10. **6 • 9 = 54**
11. **9 • 4 = 36**