Umwandeln von Multiplikationsaufgaben

Name:

Schreibe jede Anordnung als eine Multiplikationsaufgabe um und löse sie.

Bsp)



1)



2)



3)

4)

5)

6)

7)

8)



9)

10)



11)

Antworten

Bsp. 6 • 4 = 24

1. _____
2. _____
3. _____
4. _____
5. _____
6. _____
7. _____
8. _____
9. _____
10. _____
11. _____

1-10	91	82	73	64	55	45	36	27	18	9
11	0									

Umwandeln von Multiplikationsaufgaben

Name: **Lösungsschlüssel**

Schreibe jede Anordnung als eine Multiplikationsaufgabe um und löse sie.

Bsp)



1)



2)



3)

4)

5)

6)

7)

8)



9)

10)



11)

Antworten

Bsp. 6 • 4 = 24

1. 4 • 3 = 12
2. 10 • 9 = 90
3. 3 • 3 = 9
4. 7 • 2 = 14
5. 3 • 2 = 6
6. 7 • 4 = 28
7. 4 • 10 = 40
8. 10 • 6 = 60
9. 4 • 8 = 32
10. 10 • 3 = 30
11. 3 • 5 = 15

1-10	91	82	73	64	55	45	36	27	18	9
11	0									