Umwandeln von Multiplikationsaufgaben

Name:

Schreibe jede Anordnung als eine Multiplikationsaufgabe um und löse sie.

Bsp)



1)

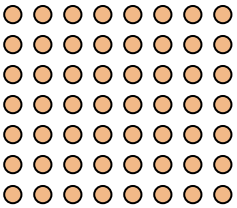

2)

3)



4)

5)



6)

7)



8)

9)

10)

11)

Antworten

Bsp. 7 • 5 = 35

1. _____
2. _____
3. _____
4. _____
5. _____
6. _____
7. _____
8. _____
9. _____
10. _____
11. _____

1-10	91	82	73	64	55	45	36	27	18	9
11	0									

Umwandeln von Multiplikationsaufgaben

Name: **Lösungsschlüssel**

Schreibe jede Anordnung als eine Multiplikationsaufgabe um und löse sie.

Bsp)



1)

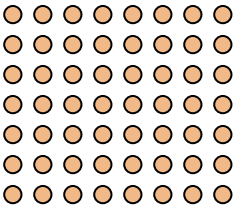

2)

3)



4)

5)



6)

7)



8)

9)

10)

11)

Antworten

Bsp. 7 • 5 = 35

1. 7 • 8 = 56
2. 6 • 2 = 12
3. 9 • 10 = 90
4. 3 • 6 = 18
5. 6 • 10 = 60
6. 10 • 9 = 90
7. 7 • 7 = 49
8. 2 • 8 = 16
9. 4 • 10 = 40
10. 2 • 3 = 6
11. 3 • 3 = 9

1-10	91	82	73	64	55	45	36	27	18	9
11	0									