Umwandeln von Multiplikationsaufgaben

Name:

Schreibe jede Anordnung als eine Multiplikationsaufgabe um und löse sie.

Bsp) 

1) 

2)

3) 

4) 

5)

6)

7) 

8) 

9) 

10)

11)

Antworten

Bsp. 3 • 5 = 15

1. _____
2. _____
3. _____
4. _____
5. _____
6. _____
7. _____
8. _____
9. _____
10. _____
11. _____

1-10	91	82	73	64	55	45	36	27	18	9
11	0									

Umwandeln von Multiplikationsaufgaben

Name: **Lösungsschlüssel**

Schreibe jede Anordnung als eine Multiplikationsaufgabe um und löse sie.

Bsp)



1)



2)

3)



4)



5)

6)

7)



8)



9)



10)



11)

Antworten

Bsp. **3 • 5 = 15**

1. **7 • 3 = 21**
2. **9 • 5 = 45**
3. **4 • 6 = 24**
4. **7 • 6 = 42**
5. **4 • 9 = 36**
6. **3 • 4 = 12**
7. **10 • 7 = 70**
8. **2 • 9 = 18**
9. **7 • 9 = 63**
10. **10 • 2 = 20**
11. **7 • 2 = 14**

1-10	91	82	73	64	55	45	36	27	18	9
11	0									