Multiplizieren mit dem Zahlenstrahl

Name:

Benutze den Zahlenstrahl um jede Aufgabe zu beantworten.

1) 5 • 4 =

4 • 5 =

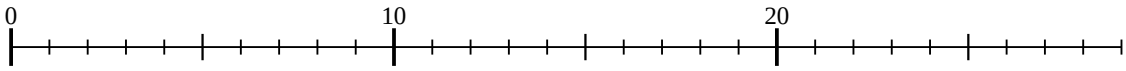

2) 5 • 8 =

8 • 5 =

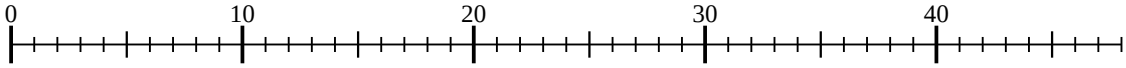

3) 4 • 9 =

9 • 4 =

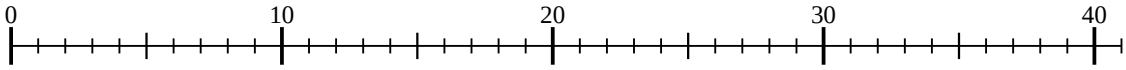

4) 3 • 10 =

10 • 3 =

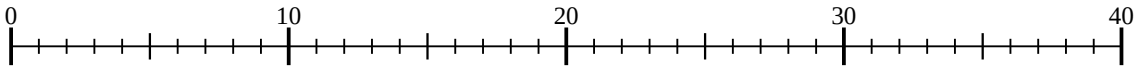

5) 2 • 6 =

6 • 2 =

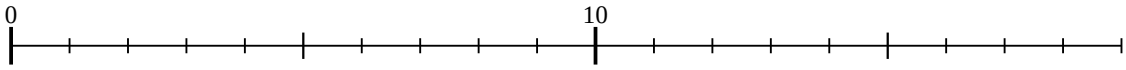

6) 3 • 7 =

7 • 3 =

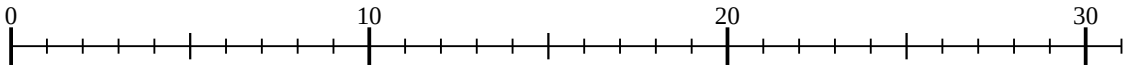

7) 4 • 10 =

10 • 4 =

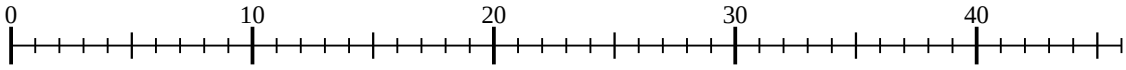

8) 3 • 3 =

3 • 3 =

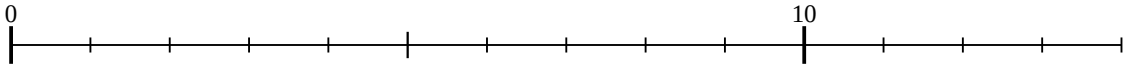

9) 4 • 4 =

4 • 4 =

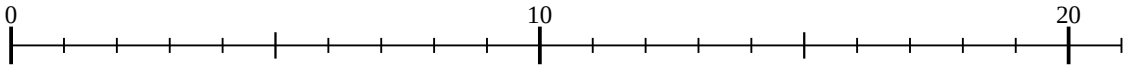

10) 3 • 5 =

5 • 3 =

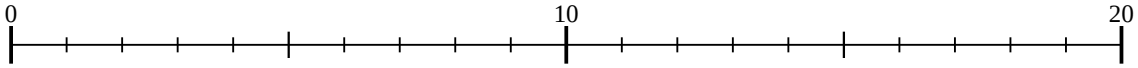

11) 4 • 2 =

2 • 4 =

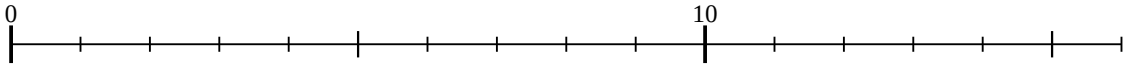

Antworten

1. _____
2. _____
3. _____
4. _____
5. _____
6. _____
7. _____
8. _____
9. _____
10. _____
11. _____

Multiplizieren mit dem Zahlenstrahl

Name: **Lösungsschlüssel**

Benutze den Zahlenstrahl um jede Aufgabe zu beantworten.

1) 5 • 4 =
4 • 5 =

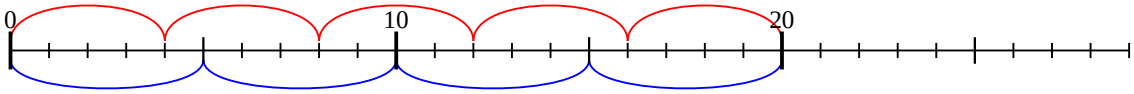

2) 5 • 8 =
8 • 5 =

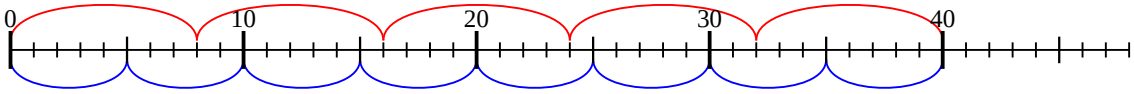

3) 4 • 9 =
9 • 4 =

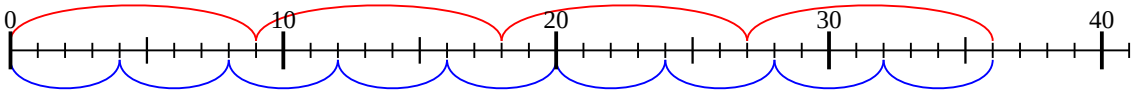

4) 3 • 10 =
10 • 3 =

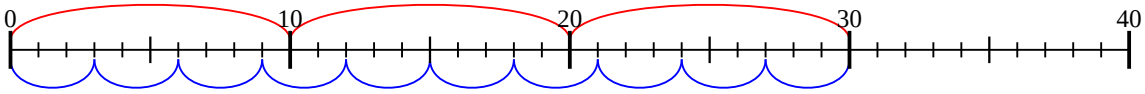

5) 2 • 6 =
6 • 2 =

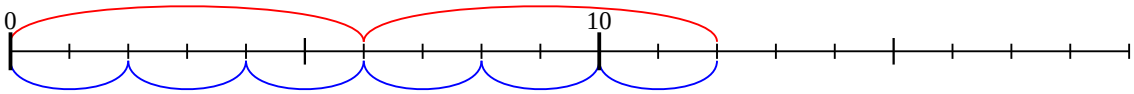

6) 3 • 7 =
7 • 3 =

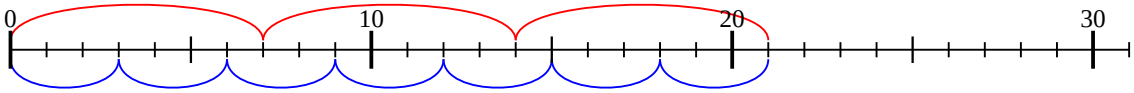

7) 4 • 10 =
10 • 4 =

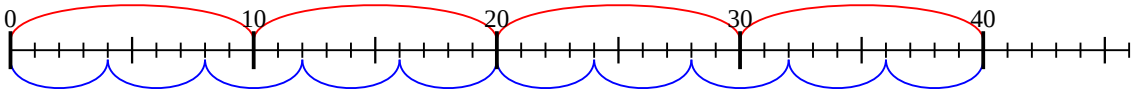

8) 3 • 3 =
3 • 3 =

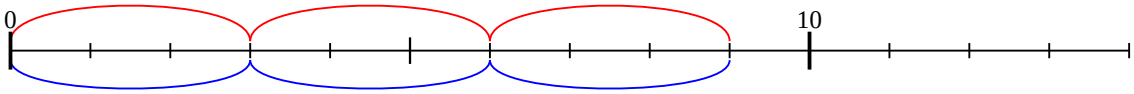

9) 4 • 4 =
4 • 4 =

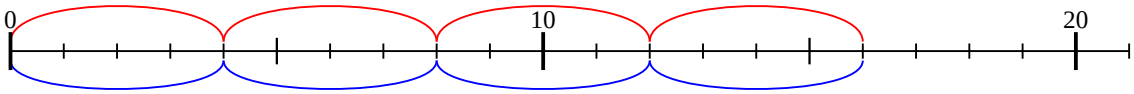

10) 3 • 5 =
5 • 3 =

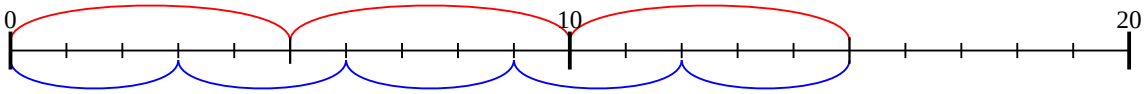

11) 4 • 2 =
2 • 4 =

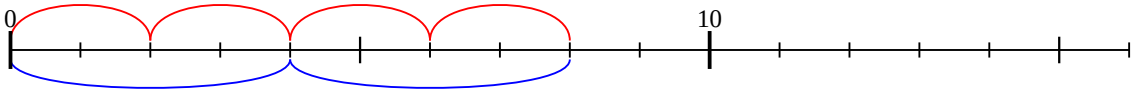

Antworten

1. **20**
2. **40**
3. **36**
4. **30**
5. **12**
6. **21**
7. **40**
8. **9**
9. **16**
10. **15**
11. **8**

1-10	91	82	73	64	55	45	36	27	18	9
11	0									