Multiplizieren mit dem Zahlenstrahl

Name:

Benutze den Zahlenstrahl um jede Aufgabe zu beantworten.

1) 3 • 8 =
8 • 3 =

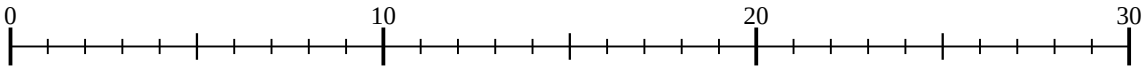

2) 5 • 9 =
9 • 5 =

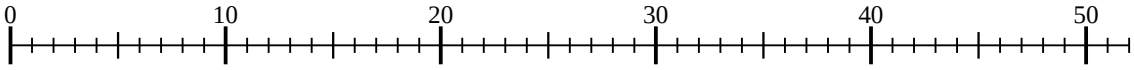

3) 5 • 10 =
10 • 5 =

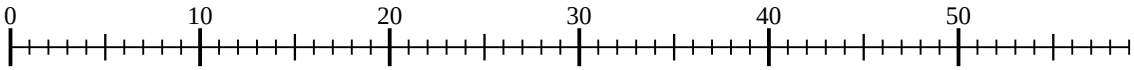

4) 2 • 3 =
3 • 2 =



5) 2 • 2 =
2 • 2 =

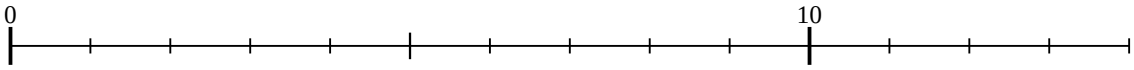

6) 3 • 3 =
3 • 3 =

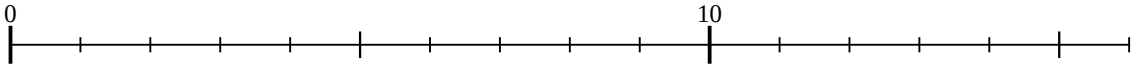

7) 3 • 6 =
6 • 3 =

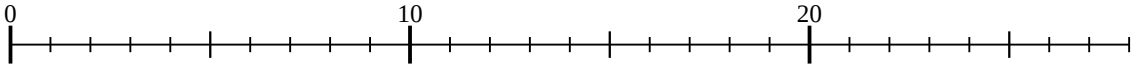

8) 5 • 2 =
2 • 5 =

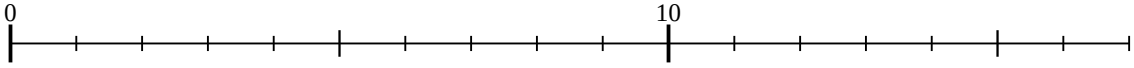

9) 3 • 5 =
5 • 3 =

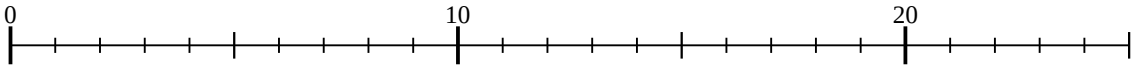

10) 2 • 5 =
5 • 2 =

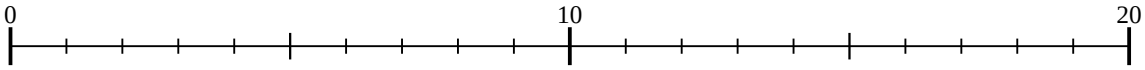

11) 5 • 5 =
5 • 5 =

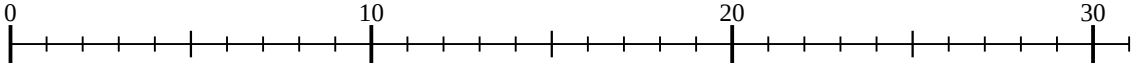

Antworten

1. _____
2. _____
3. _____
4. _____
5. _____
6. _____
7. _____
8. _____
9. _____
10. _____
11. _____

1-10	91	82	73	64	55	45	36	27	18	9
11	0									

Multiplizieren mit dem Zahlenstrahl

Name: **Lösungsschlüssel**

Benutze den Zahlenstrahl um jede Aufgabe zu beantworten.

1) 3 • 8 =
8 • 3 =

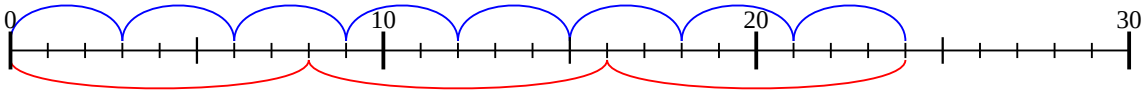

2) 5 • 9 =
9 • 5 =

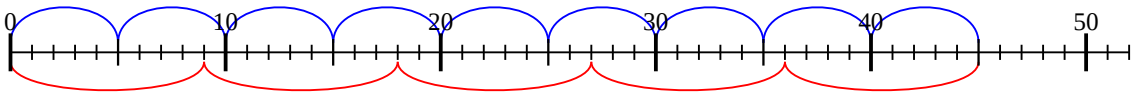

3) 5 • 10 =
10 • 5 =

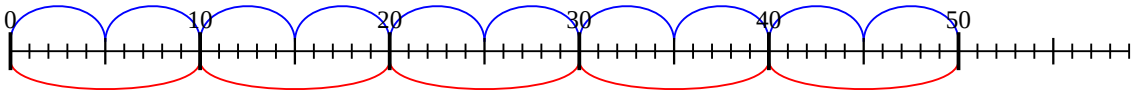

4) 2 • 3 =
3 • 2 =

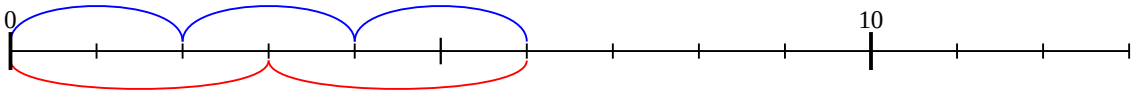

5) 2 • 2 =
2 • 2 =

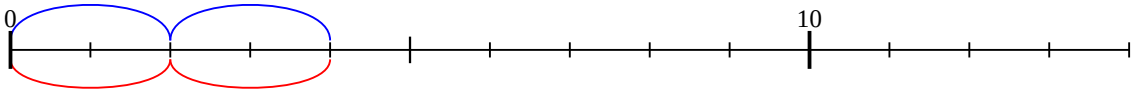

6) 3 • 3 =
3 • 3 =

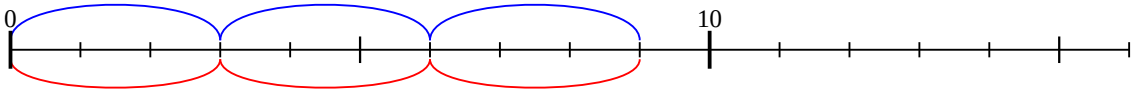

7) 3 • 6 =
6 • 3 =

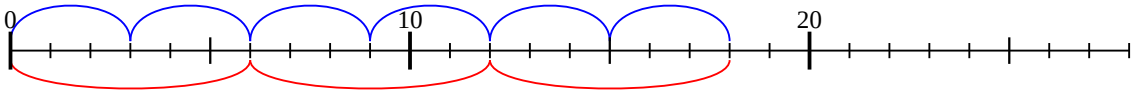

8) 5 • 2 =
2 • 5 =

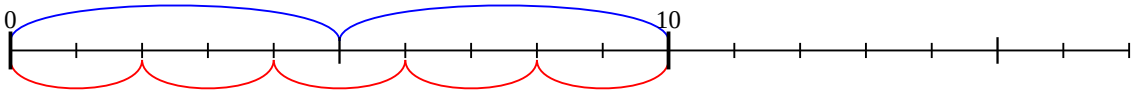

9) 3 • 5 =
5 • 3 =

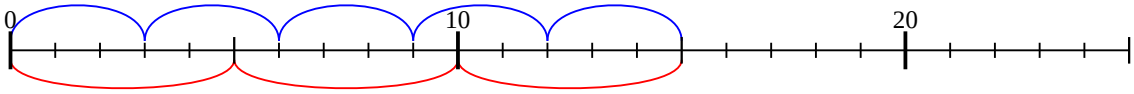

10) 2 • 5 =
5 • 2 =

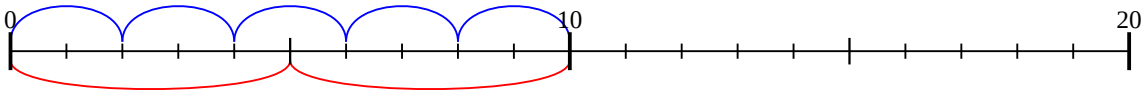

11) 5 • 5 =
5 • 5 =

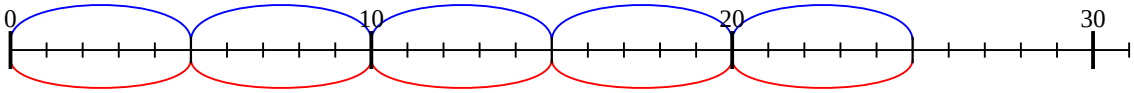

Antworten

1. **24**
2. **45**
3. **50**
4. **6**
5. **4**
6. **9**
7. **18**
8. **10**
9. **15**
10. **10**
11. **25**

1-10	91	82	73	64	55	45	36	27	18	9
11	0									