Abstand in einem Koordinatensystem finden

Name:

Finde die Distanz zwischen zwei Punkten.

Bsp)

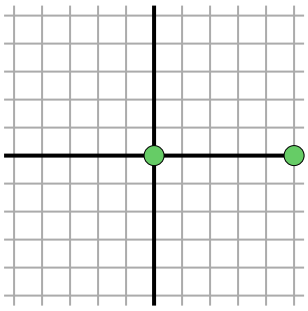

1)

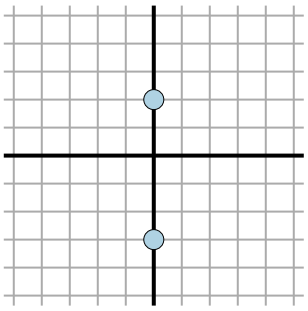

2)

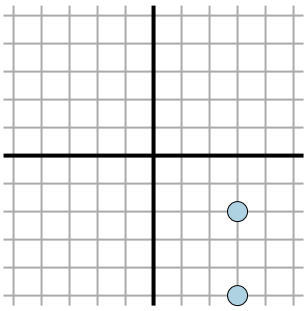

3)

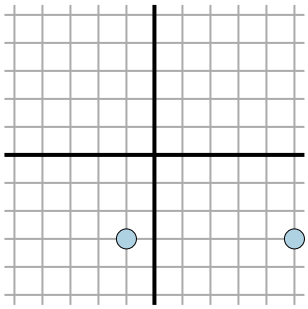

4)

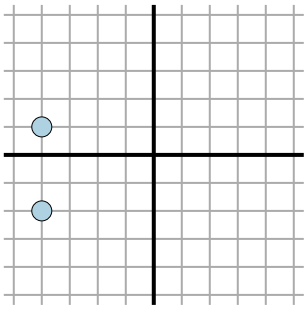

5)

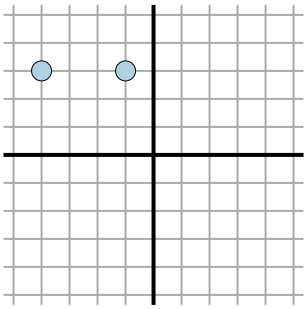

6)

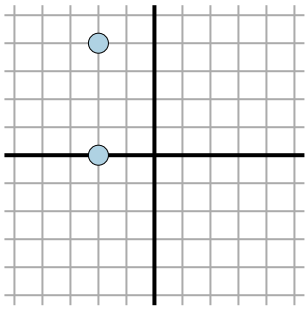

7)

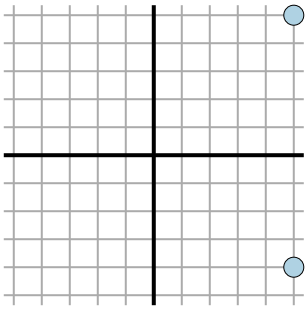

8)

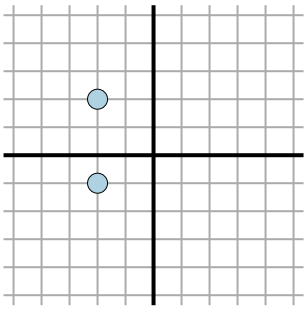

9)

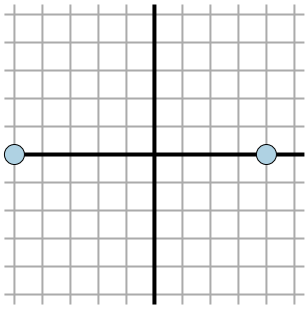

10)

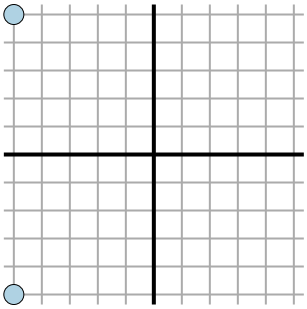

11)

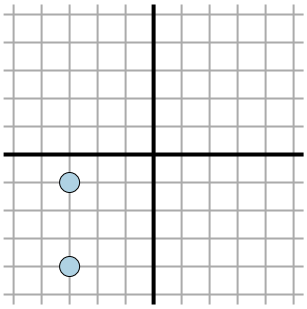

Antworten

Bsp. 5

1. _____
2. _____
3. _____
4. _____
5. _____
6. _____
7. _____
8. _____
9. _____
10. _____
11. _____

1-10	91	82	73	64	55	45	36	27	18	9
11	0									

Abstand in einem Koordinatensystem finden

Name: **Lösungsschlüssel**

Finde die Distanz zwischen zwei Punkten.

Bsp)

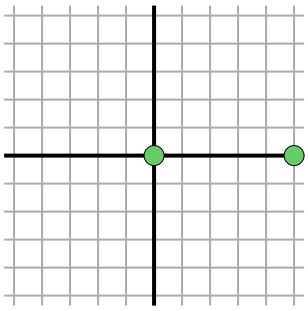

1)

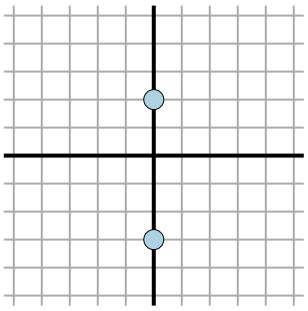

2)

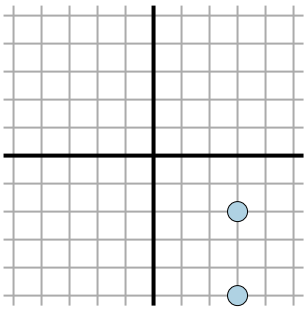

3)

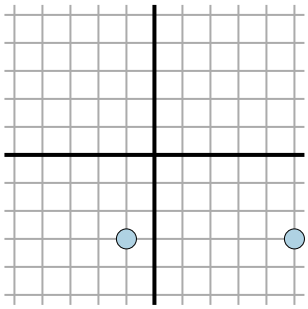

4)

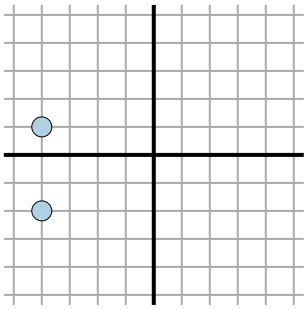

5)

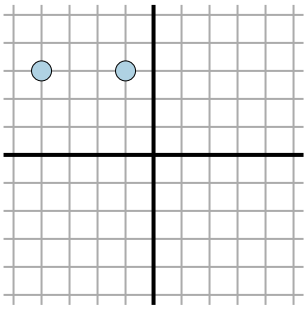

6)

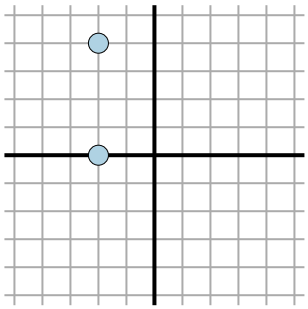

7)

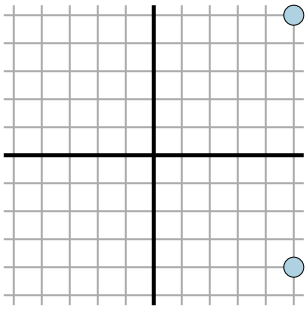

8)

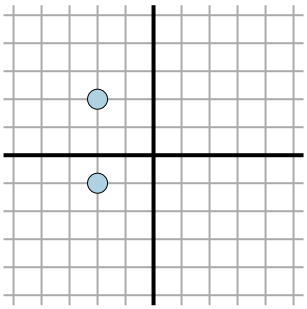

9)

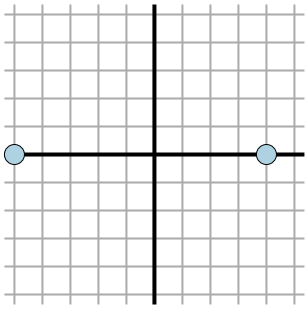

10)

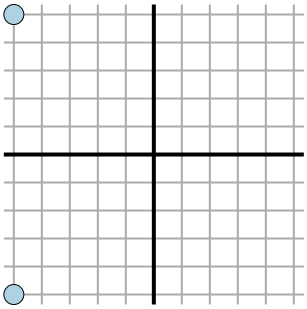

11)

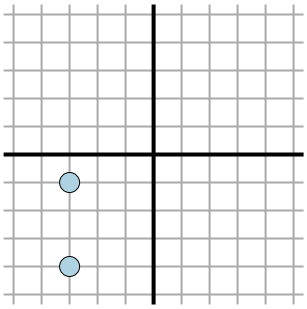

Antworten

Bsp.	5
1.	5
2.	3
3.	6
4.	3
5.	3
6.	4
7.	9
8.	3
9.	9
10.	10
11.	3

1-10	91	82	73	64	55	45	36	27	18	9
11	0									