Abstand in einem Koordinatensystem finden

Name:

Finde die Distanz zwischen zwei Punkten.

Bsp)

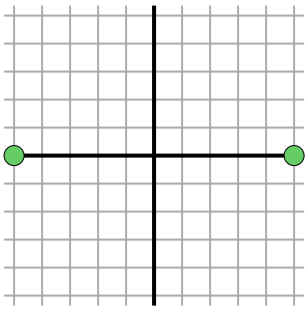

1)

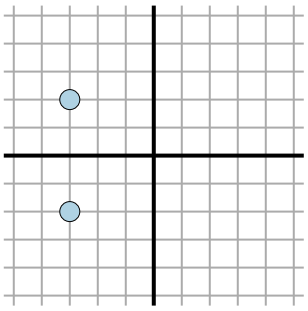

2)

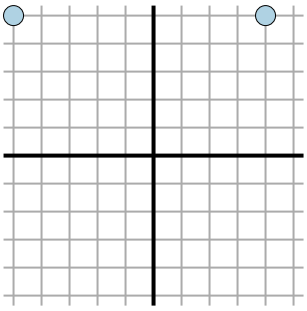

3)

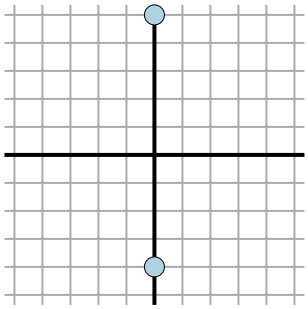

4)

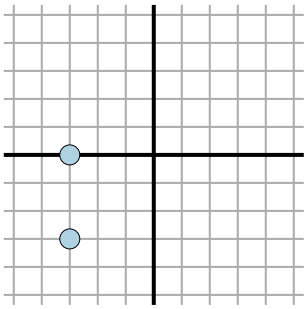

5)

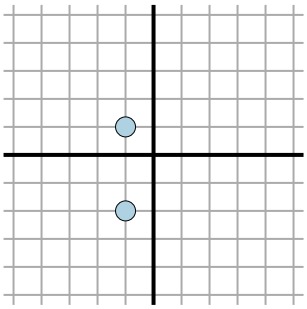

6)

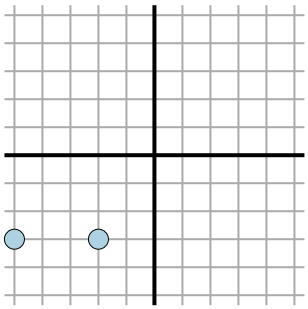

7)

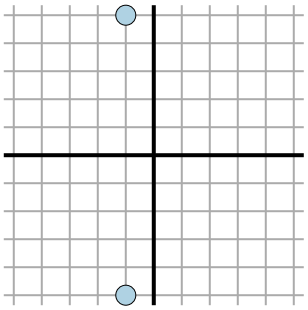

8)

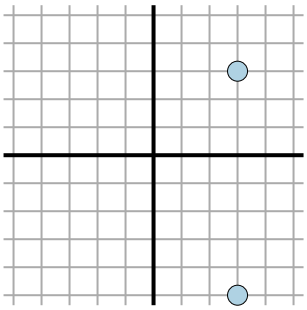

9)

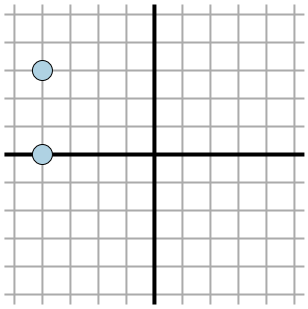

10)

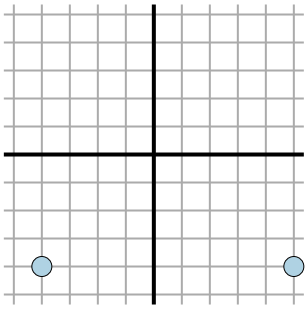

11)

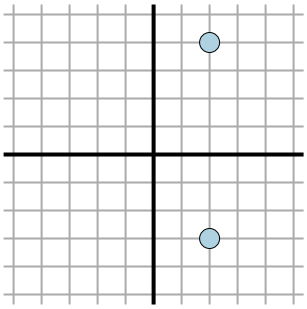

Antworten

Bsp. 10

1. _____
2. _____
3. _____
4. _____
5. _____
6. _____
7. _____
8. _____
9. _____
10. _____
11. _____

1-10	91	82	73	64	55	45	36	27	18	9
11	0									

Abstand in einem Koordinatensystem finden

Name: **Lösungsschlüssel**

Finde die Distanz zwischen zwei Punkten.

Bsp)

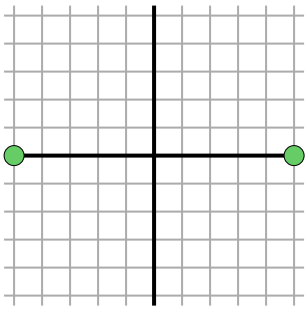

1)

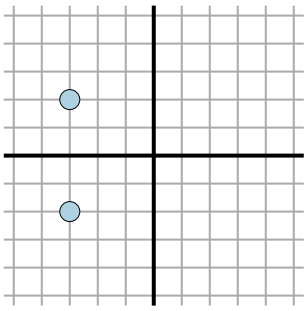

2)

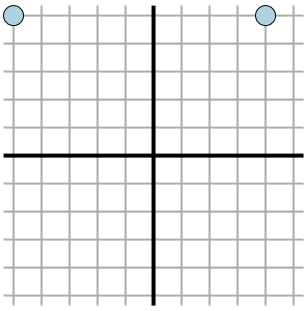

3)

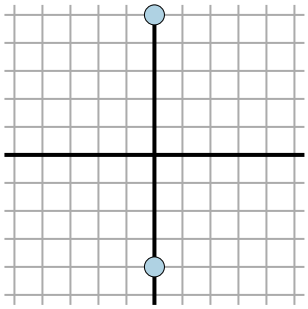

4)

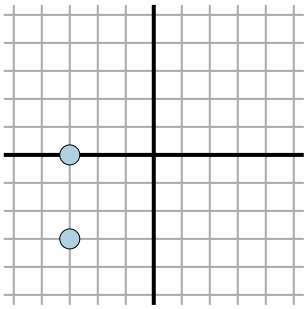

5)

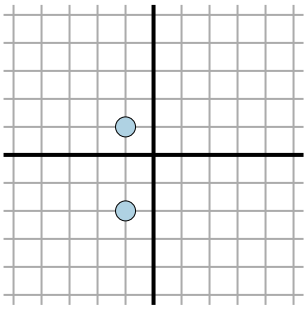

6)

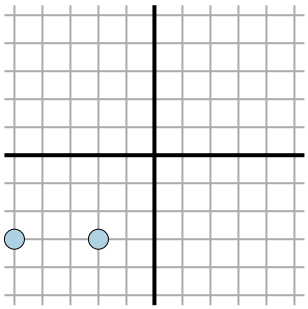

7)

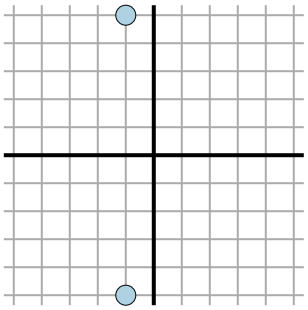

8)

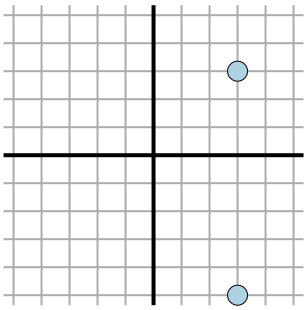

9)

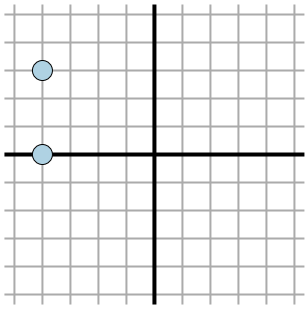

10)

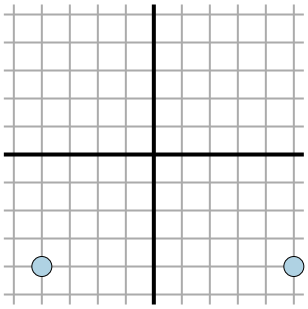

11)

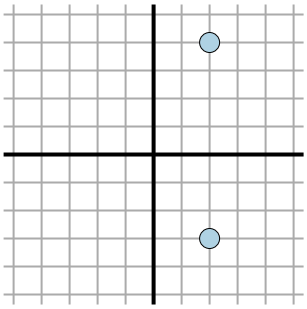

Antworten

Bsp.	10
1.	4
2.	9
3.	9
4.	3
5.	3
6.	3
7.	10
8.	8
9.	3
10.	9
11.	7

1-10	91	82	73	64	55	45	36	27	18	9
11	0									