Abstand in einem Koordinatensystem finden

Name:

Finde die Distanz zwischen zwei Punkten.

Bsp)

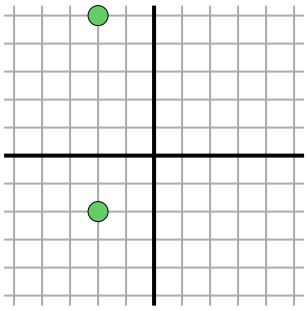

1)

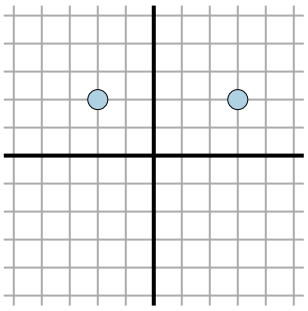

2)

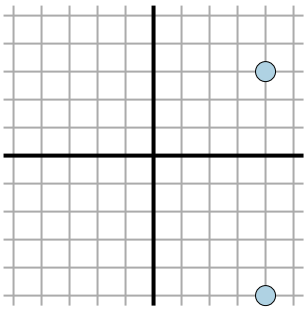

3)

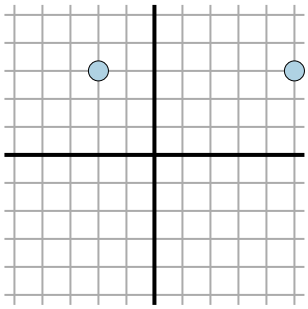

4)

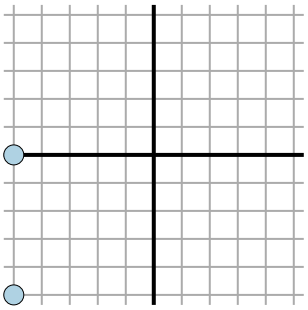

5)

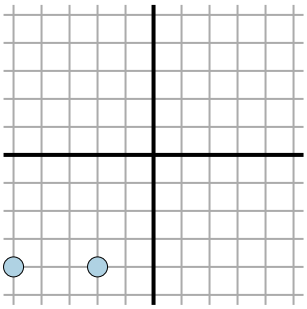

6)

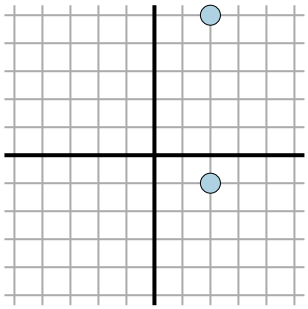

7)

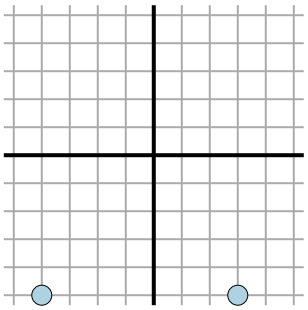

8)

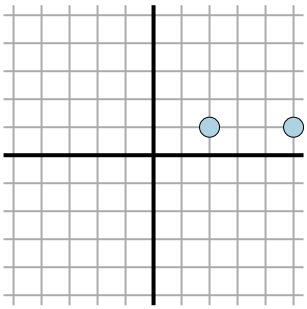

9)

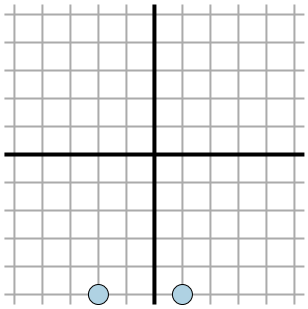

10)

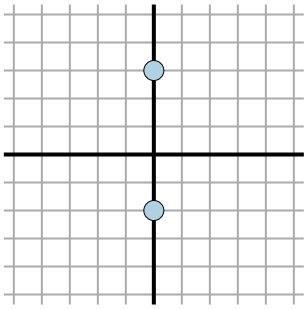

11)

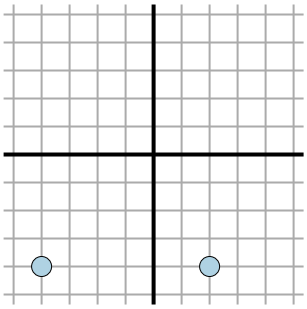

Antworten

Bsp. 7

1. _____
2. _____
3. _____
4. _____
5. _____
6. _____
7. _____
8. _____
9. _____
10. _____
11. _____

1-10	91	82	73	64	55	45	36	27	18	9
11	0									

Abstand in einem Koordinatensystem finden

Name: **Lösungsschlüssel**

Finde die Distanz zwischen zwei Punkten.

Bsp)

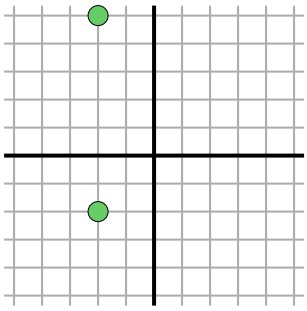

1)

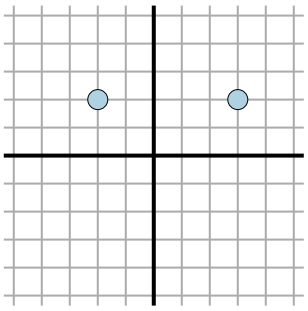

2)

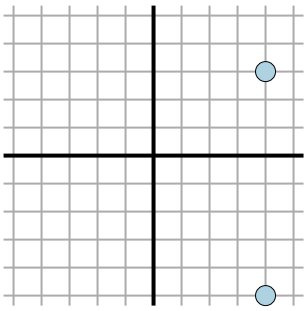

3)

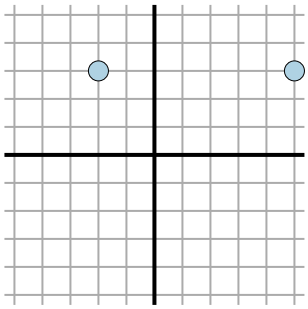

4)

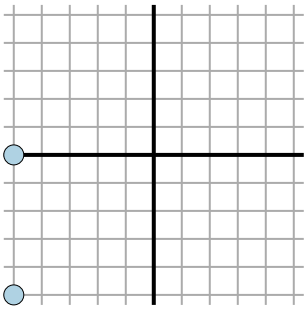

5)

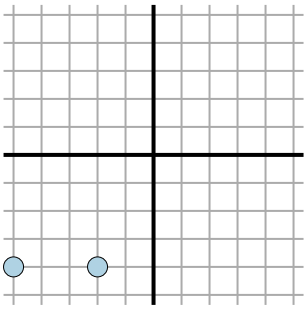

6)

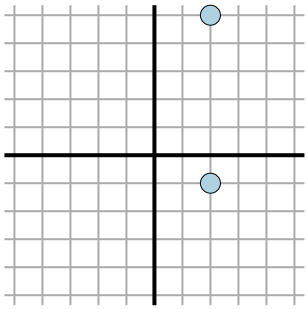

7)

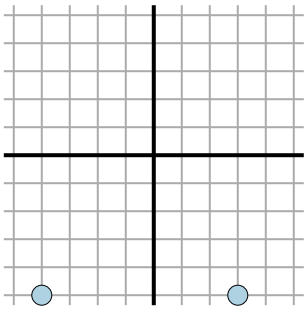

8)

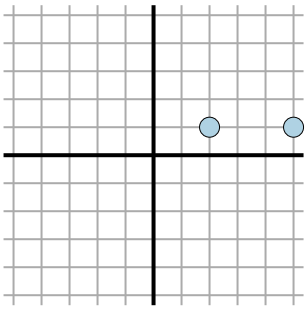

9)

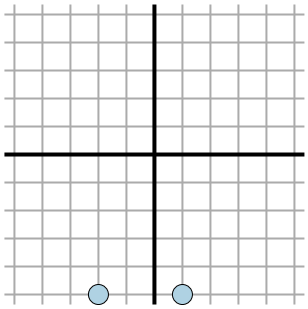

10)

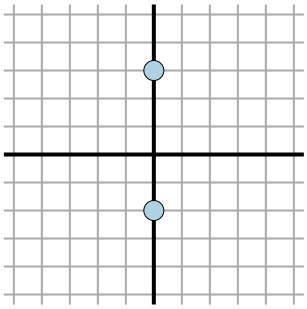

11)

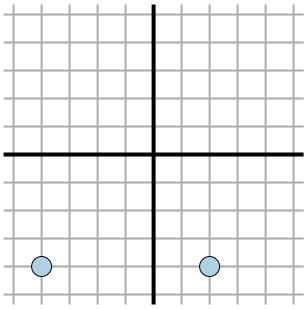

Antworten

Bsp.	7
1.	5
2.	8
3.	7
4.	5
5.	3
6.	6
7.	7
8.	3
9.	3
10.	5
11.	6

1-10	91	82	73	64	55	45	36	27	18	9
11	0									