Zählen von Figuren

Name:

**Zähle die Anzahl von Formen in jedem Feld.**

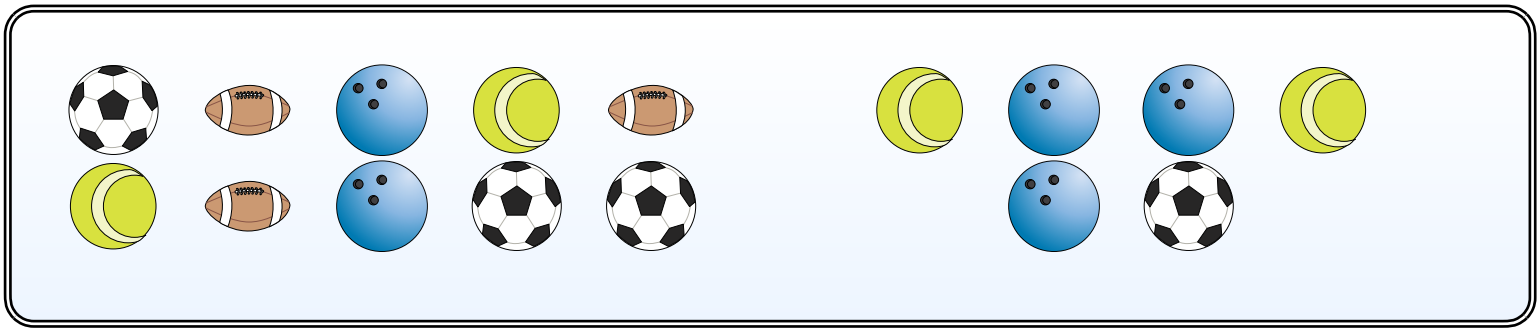

= 4

= _____

 = _____

= _____

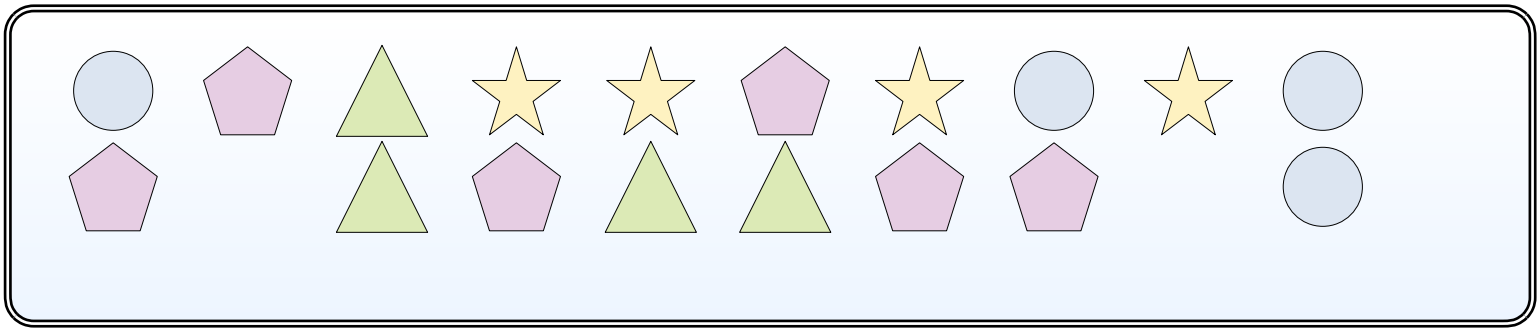

= _____

= _____

= _____

= _____



= _____

= _____

= _____

 = _____



| | | | | | | | | | | |
|---|---|---|---|---|---|---|---|---|---|---|
| 1-10 | 91 | 82 | 73 | 64 | 55 | 45 | 36 | 27 | 18 | 9 |
| 11 | 0 | | | | | | | | | |

Zählen von Figuren

Name: **Lösungsschlüssel**

**Zähle die Anzahl von Formen in jedem Feld.**

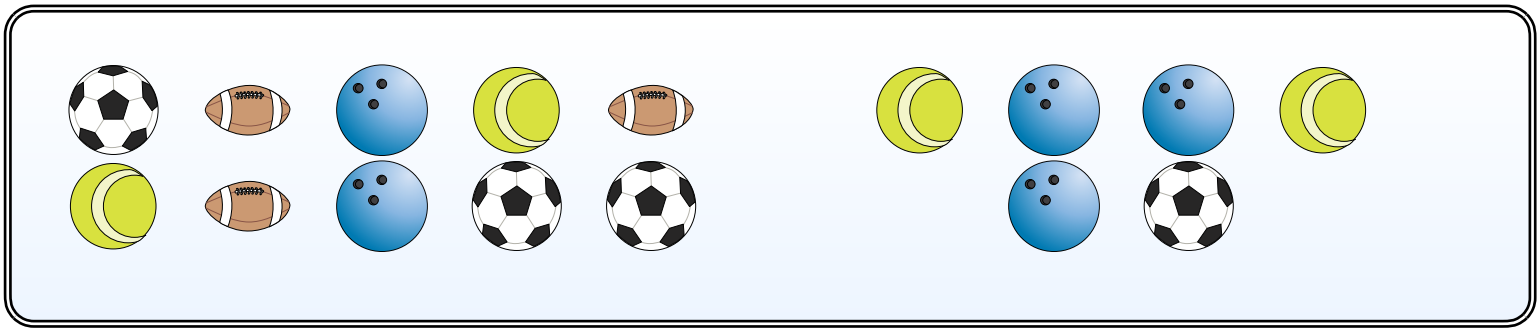

= 4

= 3

 = 5

= 4

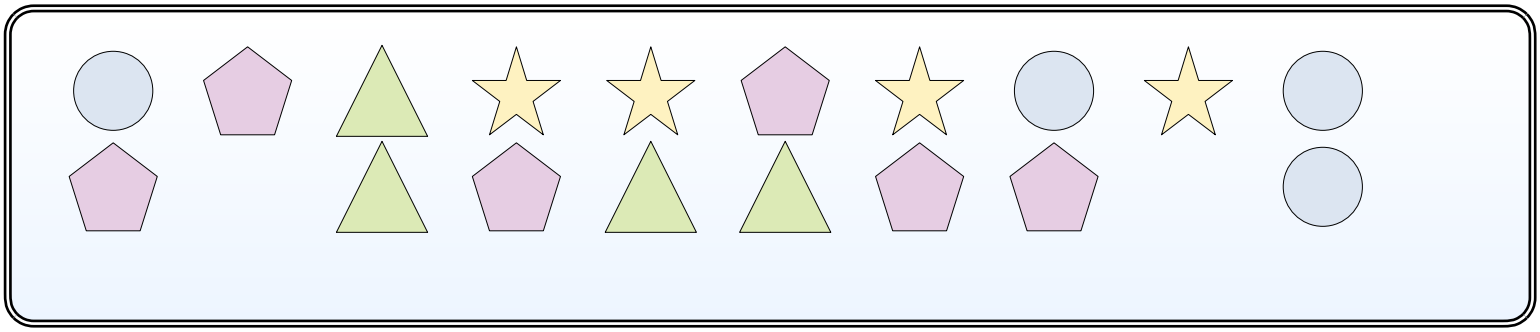

= 4

= 6

= 4

= 4



= 5

= 3

= 6

 = 5



| | | | | | | | | | | |
|---|---|---|---|---|---|---|---|---|---|---|
| 1-10 | 91 | 82 | 73 | 64 | 55 | 45 | 36 | 27 | 18 | 9 |
| 11 | 0 | | | | | | | | | |