Addieren und Subtrahieren

Name:

**Stelle fest, welche Regel die Funktionsmaschine anwendet.**

**Bsp)**

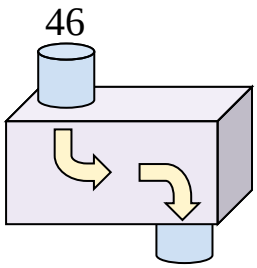


subtrahiere 16

**1)**

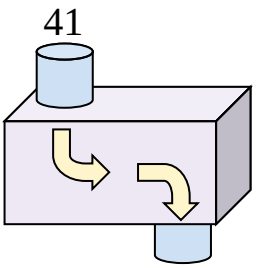


**2)**

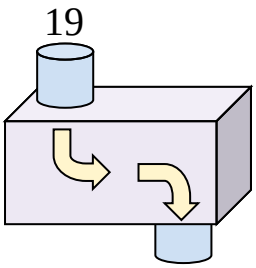


**3)**

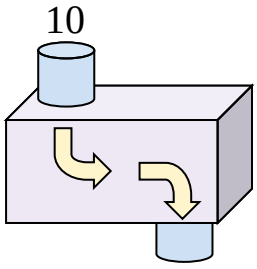


**4)**

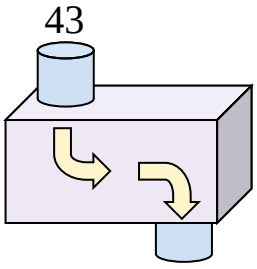


**5)**

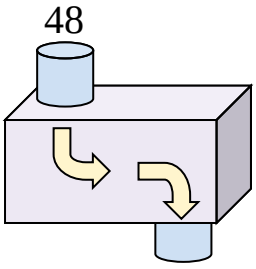


**6)**

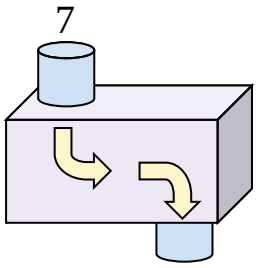


**7)**

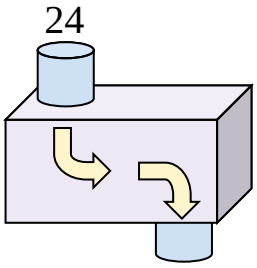


**8)**

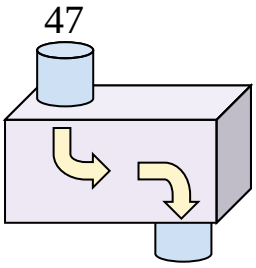


**9)**

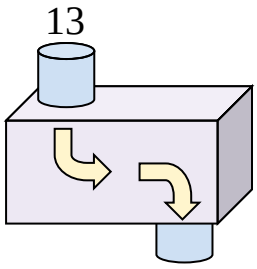


**10)**

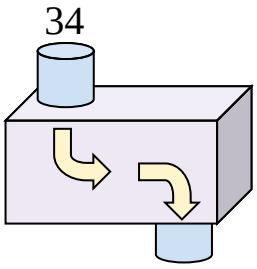


**11)**

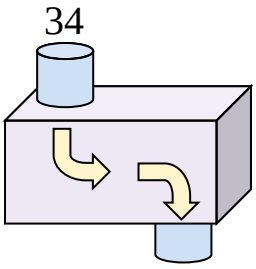


## Antworten

Bsp. subtrahiere 16

1. _____
2. _____
3. _____
4. _____
5. _____
6. _____
7. _____
8. _____
9. _____
10. _____
11. _____



| | | | | | | | | | | |
|---|---|---|---|---|---|---|---|---|---|---|
| 1-10 | 91 | 82 | 73 | 64 | 55 | 45 | 36 | 27 | 18 | 9 |
| 11 | 0 | | | | | | | | | |

Name: **Lösungsschlüssel**

**Stelle fest, welche Regel die Funktionsmaschine anwendet.**

**Bsp)**

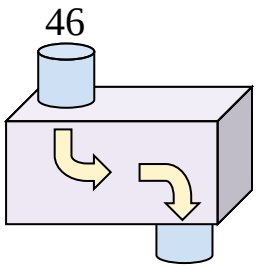


subtrahiere 16

**1)**

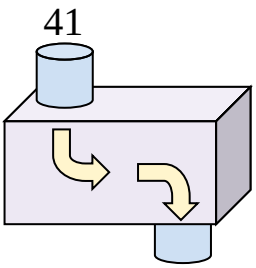


subtrahiere 16

**2)**

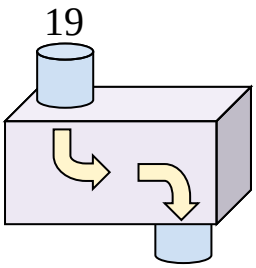


addiere 25

**3)**

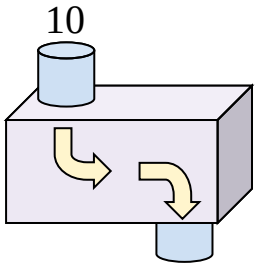


addiere 39

**4)**

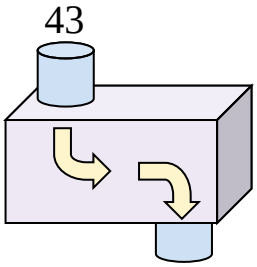


subtrahiere 17

**5)**

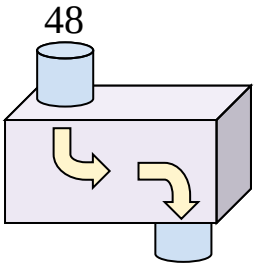


subtrahiere 29

**6)**

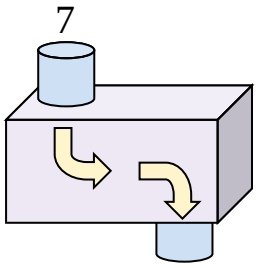


addiere 12

**7)**

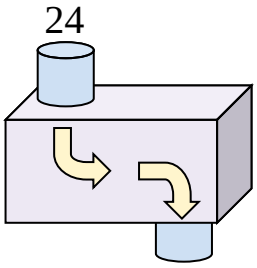


addiere 5

**8)**

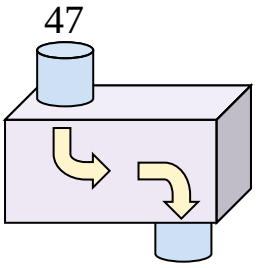


subtrahiere 17

**9)**

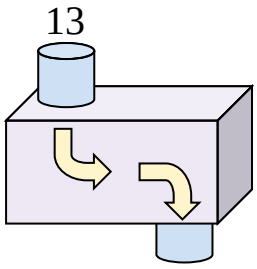


addiere 17

**10)**

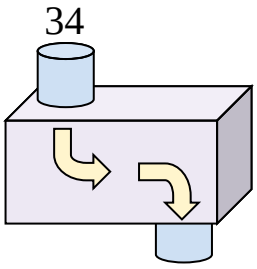


subtrahiere 9

**11)**

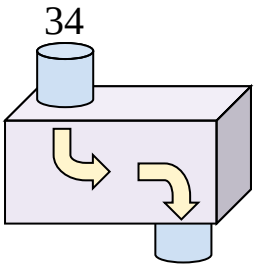


subtrahiere 9

## Antworten

Bsp. subtrahiere 16

1. subtrahiere 16
2. addiere 25
3. addiere 39
4. subtrahiere 17
5. subtrahiere 29
6. addiere 12
7. addiere 5
8. subtrahiere 17
9. addiere 17
10. subtrahiere 9
11. subtrahiere 9



| | | | | | | | | | | |
|---|---|---|---|---|---|---|---|---|---|---|
| 1-10 | 91 | 82 | 73 | 64 | 55 | 45 | 36 | 27 | 18 | 9 |
| 11 | 0 | | | | | | | | | |