Stelle fest, welche Regel die Funktionsmaschine anwendet.

Bsp)

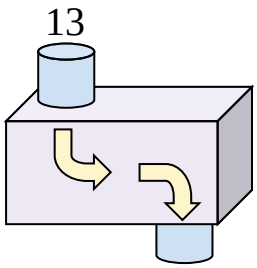

addiere 16

1)

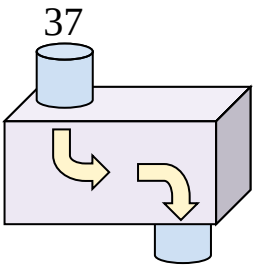

2)

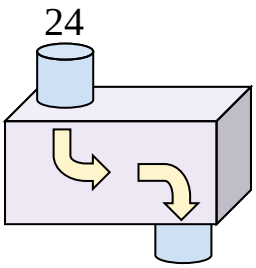

3)

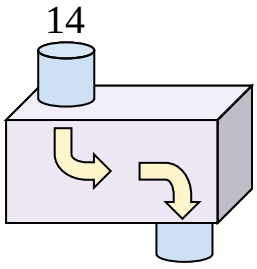

4)

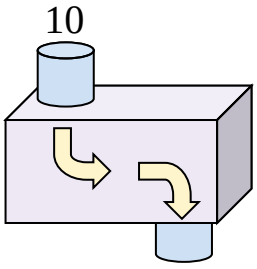

5)

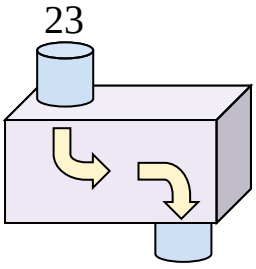

6)

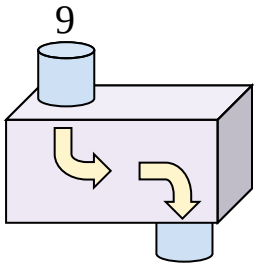

7)

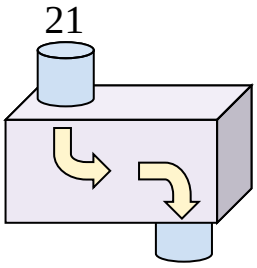

8)

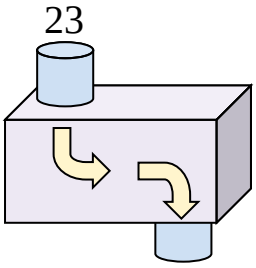

9)

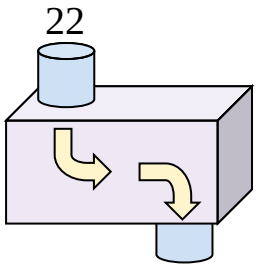

10)

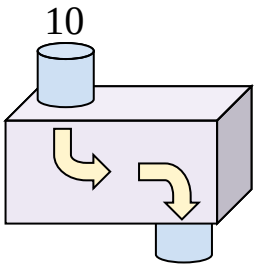

11)

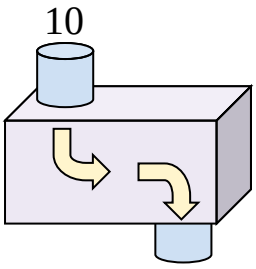

Antworten

Bsp. addiere 16

1. _____
2. _____
3. _____
4. _____
5. _____
6. _____
7. _____
8. _____
9. _____
10. _____
11. _____

1-10	91	82	73	64	55	45	36	27	18	9
11	0									

Stelle fest, welche Regel die Funktionsmaschine anwendet.

Bsp)

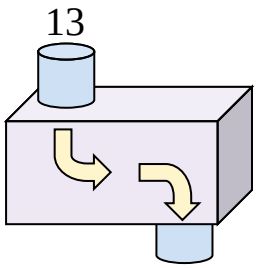

addiere 16

1)

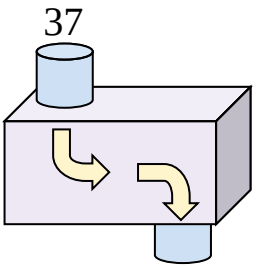

subtrahiere 8

2)

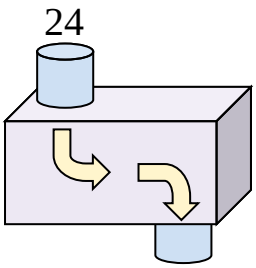

subtrahiere 18

3)

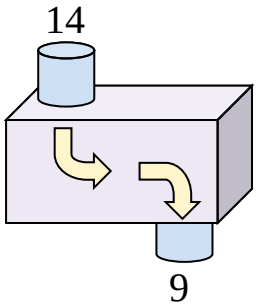

subtrahiere 5

4)

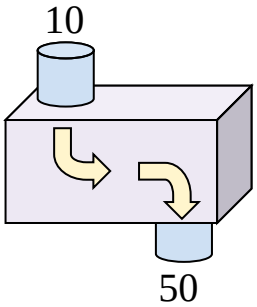

addiere 40

5)

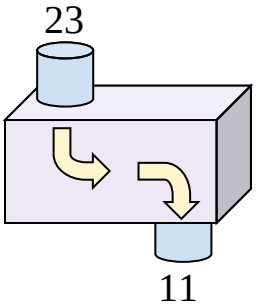

subtrahiere 12

6)

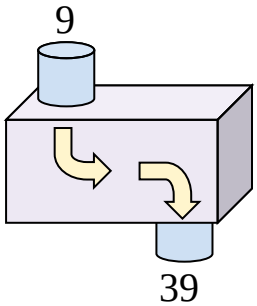

addiere 30

7)

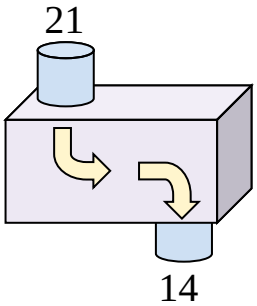

subtrahiere 7

8)

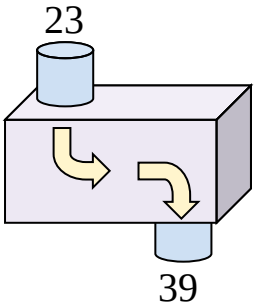

addiere 16

9)

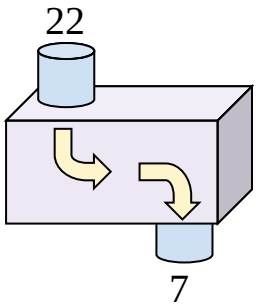

subtrahiere 15

10)

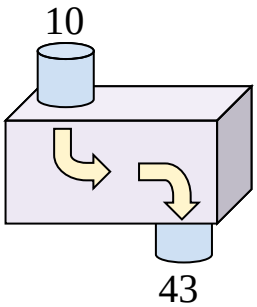

addiere 33

11)

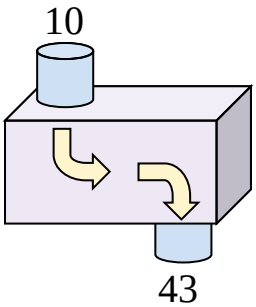

addiere 33

Antworten

Bsp. addiere 16

1. subtrahiere 8
2. subtrahiere 18
3. subtrahiere 5
4. addiere 40
5. subtrahiere 12
6. addiere 30
7. subtrahiere 7
8. addiere 16
9. subtrahiere 15
10. addiere 33
11. addiere 33

1-10	91	82	73	64	55	45	36	27	18	9
11	0									