Addieren und Subtrahieren

Name:

Stelle fest, welche Regel die Funktionsmaschine anwendet.

Bsp)

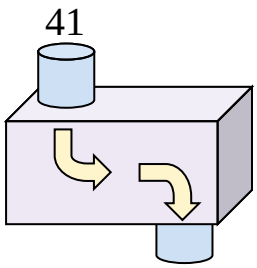

subtrahiere 34

1)

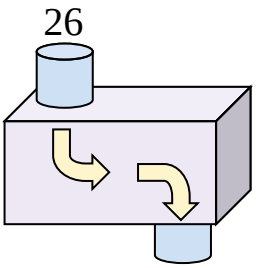

2)

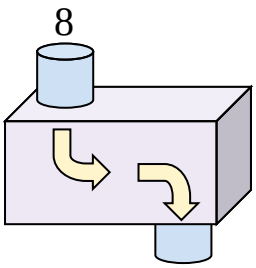

3)

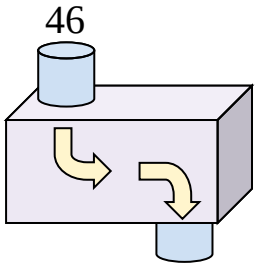

4)

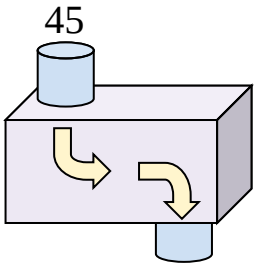

5)

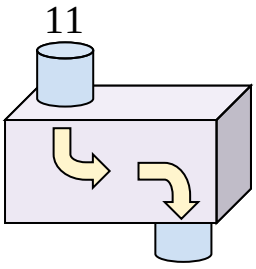

6)

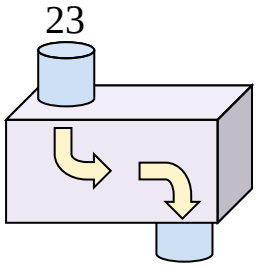

7)

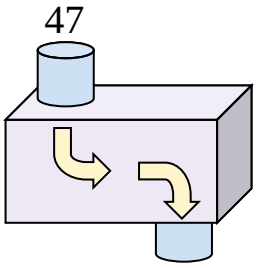

8)

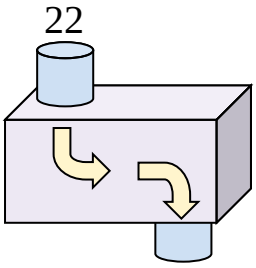

9)

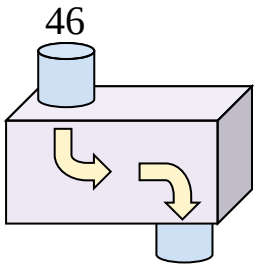

10)

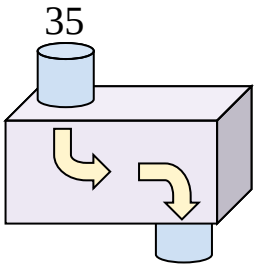

11)

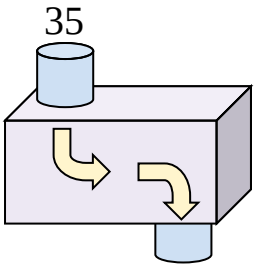

Antworten

Bsp. subtrahiere 34

1. _____
2. _____
3. _____
4. _____
5. _____
6. _____
7. _____
8. _____
9. _____
10. _____
11. _____

1-10	91	82	73	64	55	45	36	27	18	9
11	0									

Stelle fest, welche Regel die Funktionsmaschine anwendet.

Bsp)

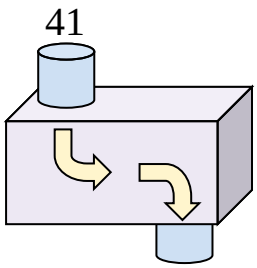

subtrahiere 34

1)

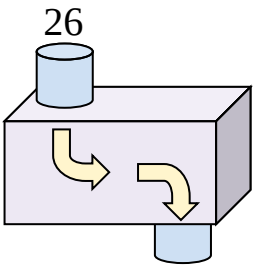

addiere 16

2)

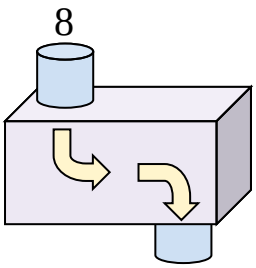

addiere 36

3)

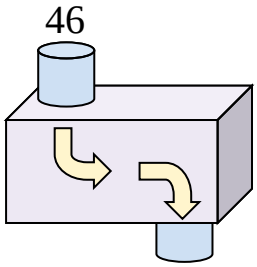

subtrahiere 32

4)

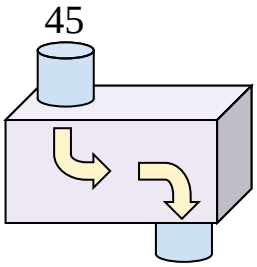

subtrahiere 15

5)

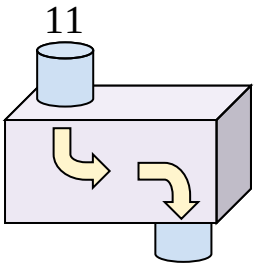

addiere 23

6)

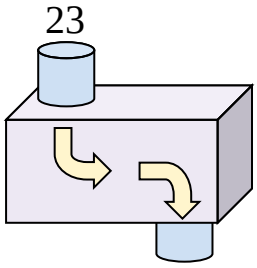

addiere 24

7)

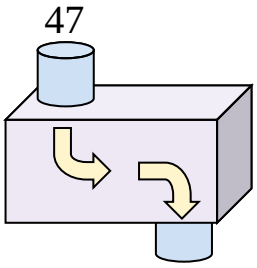

subtrahiere 36

8)

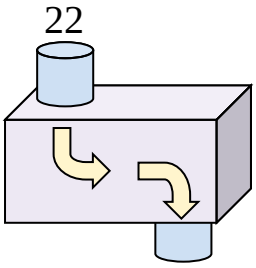

addiere 16

9)

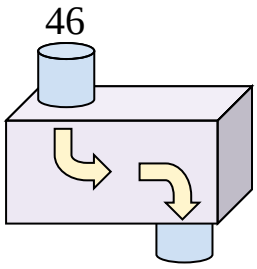

subtrahiere 26

10)

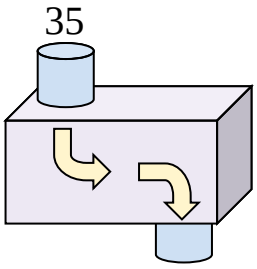

subtrahiere 7

11)

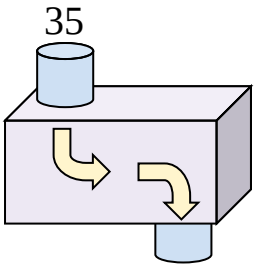

subtrahiere 7

Antworten

Bsp. subtrahiere 34

1. addiere 16
2. addiere 36
3. subtrahiere 32
4. subtrahiere 15
5. addiere 23
6. addiere 24
7. subtrahiere 36
8. addiere 16
9. subtrahiere 26
10. subtrahiere 7
11. subtrahiere 7

1-10	91	82	73	64	55	45	36	27	18	9
11	0									