Stelle fest, welche Regel die Funktionsmaschine anwendet.

Bsp)

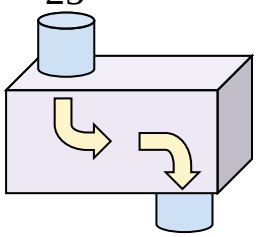

addiere 11

1)

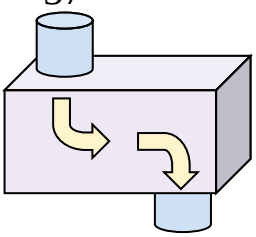

2)

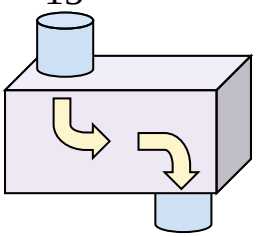

3)

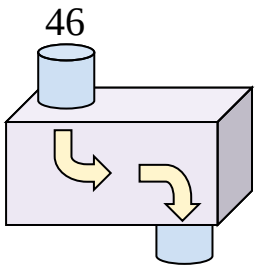

4)

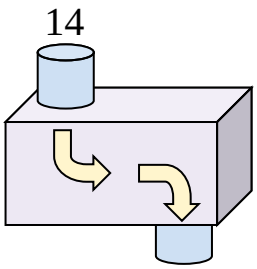

5)

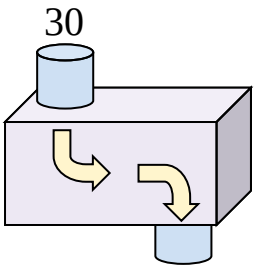

6)

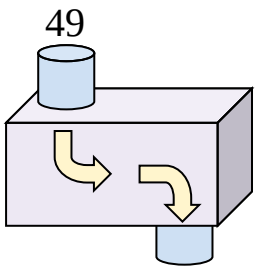

7)

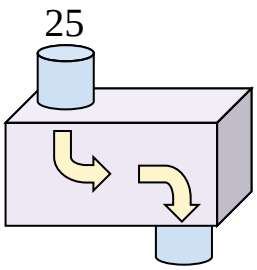

8)

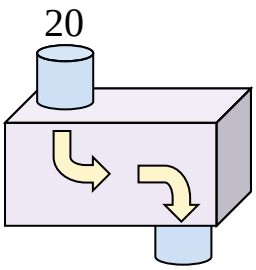

9)

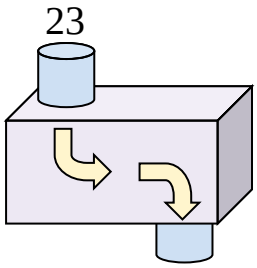

10)

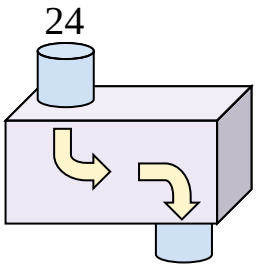

11)

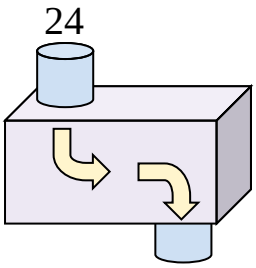

Antworten

Bsp. addiere 11

1. _____
2. _____
3. _____
4. _____
5. _____
6. _____
7. _____
8. _____
9. _____
10. _____
11. _____

1-10	91	82	73	64	55	45	36	27	18	9
11	0									

Stelle fest, welche Regel die Funktionsmaschine anwendet.

Bsp)

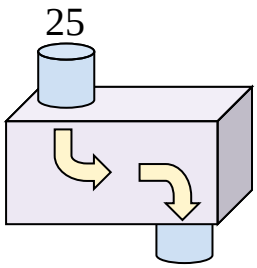

addiere 11

1)

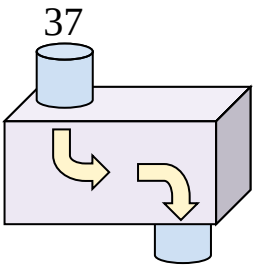

subtrahiere 7

2)

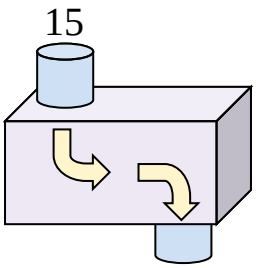

addiere 13

3)

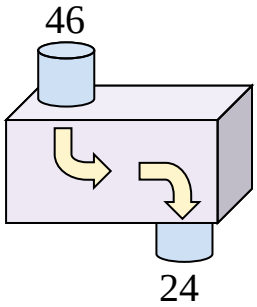

subtrahiere 22

4)

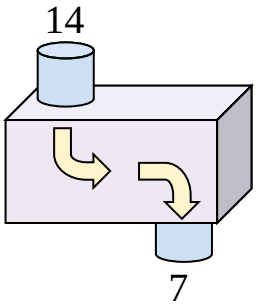

subtrahiere 7

5)

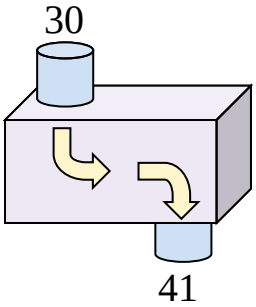

addiere 11

6)

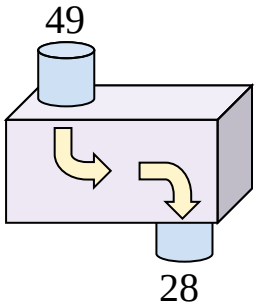

subtrahiere 21

7)

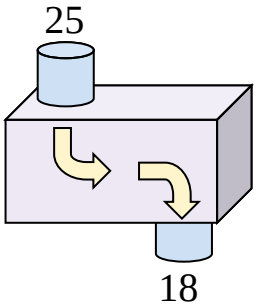

subtrahiere 7

8)

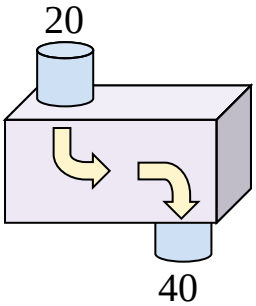

addiere 20

9)

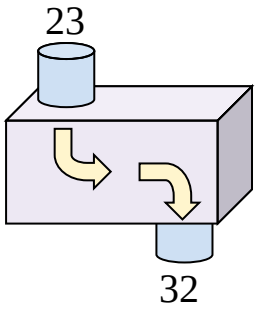

addiere 9

10)

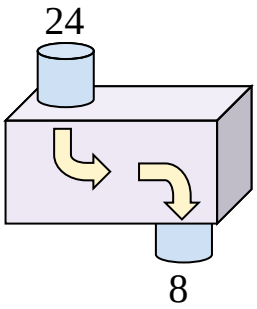

subtrahiere 16

11)

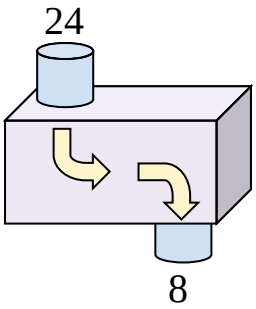

subtrahiere 16

Antworten

Bsp. addiere 11

1. subtrahiere 7
2. addiere 13
3. subtrahiere 22
4. subtrahiere 7
5. addiere 11
6. subtrahiere 21
7. subtrahiere 7
8. addiere 20
9. addiere 9
10. subtrahiere 16
11. subtrahiere 16

1-10	91	82	73	64	55	45	36	27	18	9
11	0									