Addieren und Subtrahieren

Name:

Stelle fest, welche Regel die Funktionsmaschine anwendet.

Bsp)

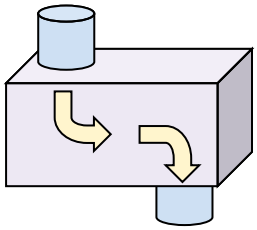

subtrahiere 14

1)

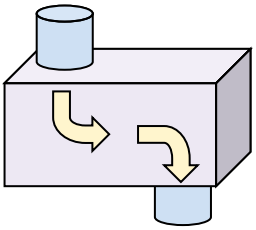

2)

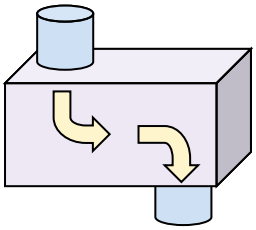

3)

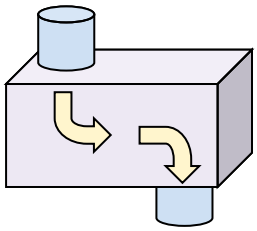

4)

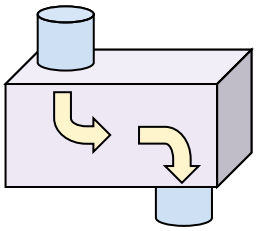

5)

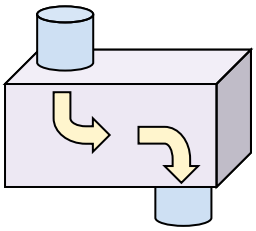

6)

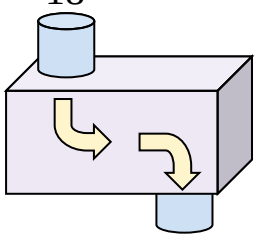

7)

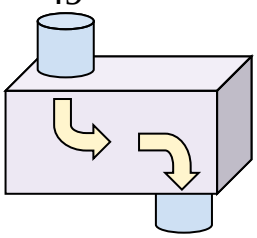

8)

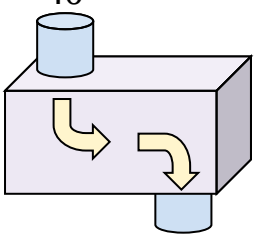

9)

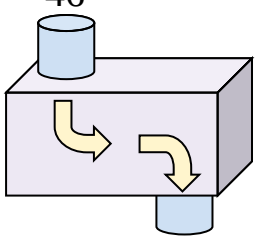

10)

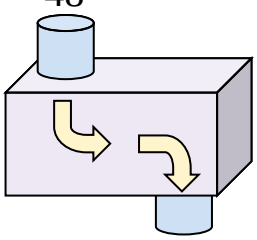

11)

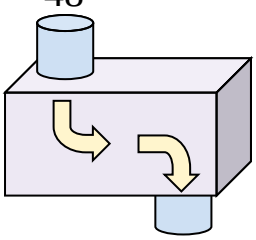

Antworten

Bsp. subtrahiere 14

1. _____
2. _____
3. _____
4. _____
5. _____
6. _____
7. _____
8. _____
9. _____
10. _____
11. _____

1-10	91	82	73	64	55	45	36	27	18	9
11	0									

Stelle fest, welche Regel die Funktionsmaschine anwendet.

Bsp)

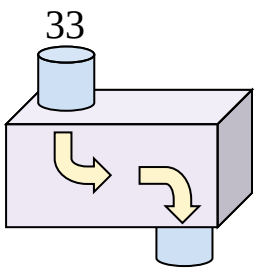

subtrahiere 14

1)

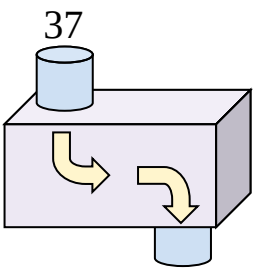

subtrahiere 24

2)

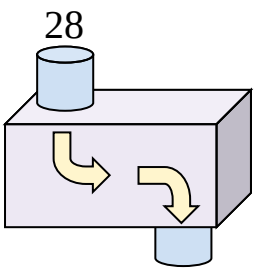

addiere 10

3)

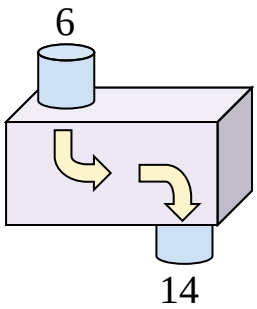

addiere 8

4)

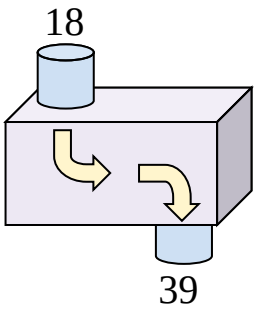

addiere 21

5)

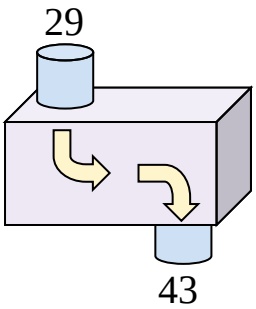

addiere 14

6)

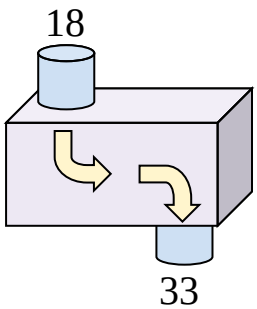

addiere 15

7)

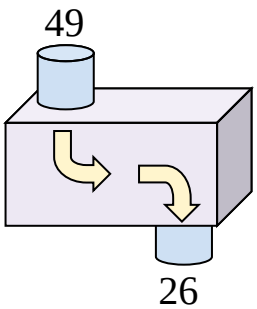

subtrahiere 23

8)

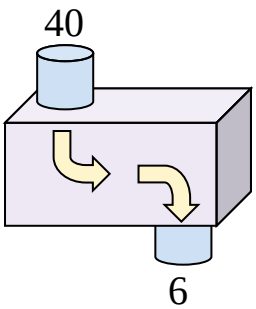

subtrahiere 34

9)

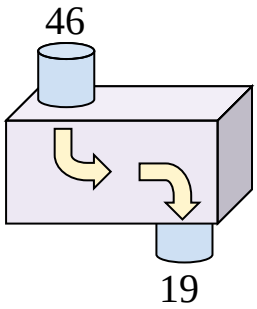

subtrahiere 27

10)

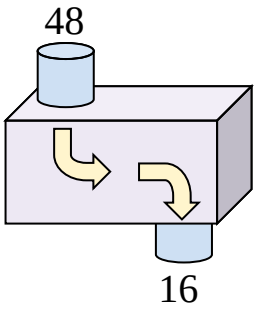

subtrahiere 32

11)

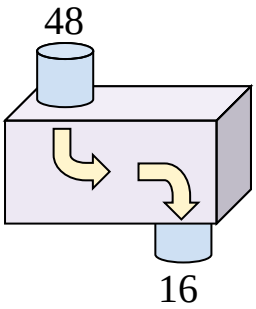

subtrahiere 32

Antworten

Bsp. subtrahiere 14

1. subtrahiere 24
2. addiere 10
3. addiere 8
4. addiere 21
5. addiere 14
6. addiere 15
7. subtrahiere 23
8. subtrahiere 34
9. subtrahiere 27
10. subtrahiere 32
11. subtrahiere 32

1-10	91	82	73	64	55	45	36	27	18	9
11	0									