Addieren und Subtrahieren

Name:

Stelle fest, welche Regel die Funktionsmaschine anwendet.

Bsp)

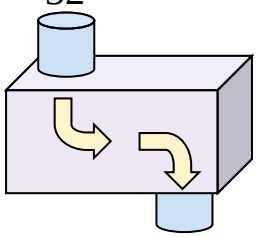

subtrahiere 16

1)

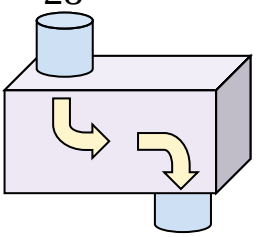

2)

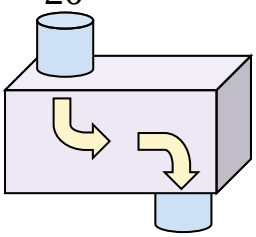

3)

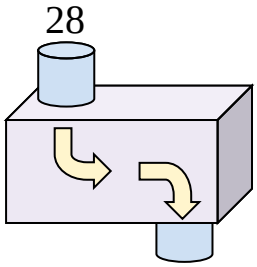

4)

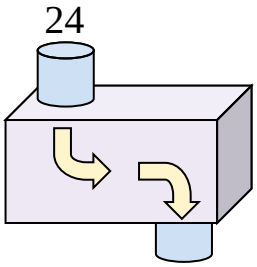

5)

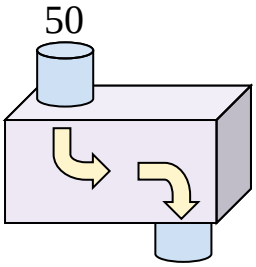

6)

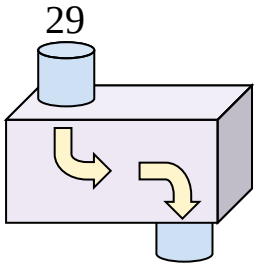

7)

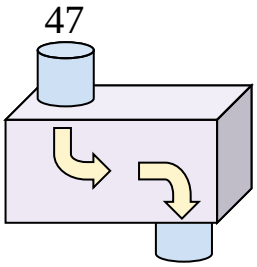

8)

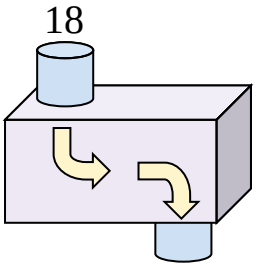

9)

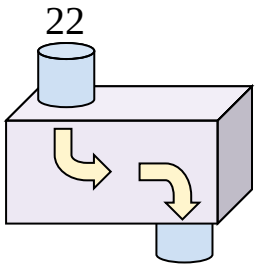

10)

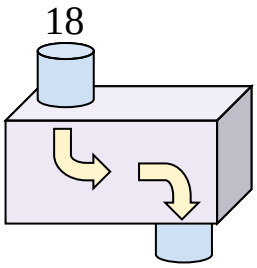

11)

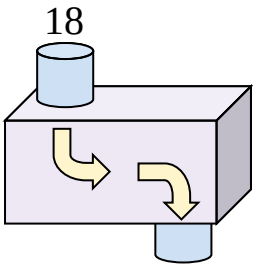

Antworten

Bsp. subtrahiere 16

1. _____
2. _____
3. _____
4. _____
5. _____
6. _____
7. _____
8. _____
9. _____
10. _____
11. _____

1-10	91	82	73	64	55	45	36	27	18	9
11	0									

Addieren und Subtrahieren

Name: **Lösungsschlüssel**

Stelle fest, welche Regel die Funktionsmaschine anwendet.

Bsp)

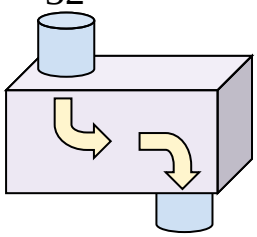

subtrahiere 16

1)

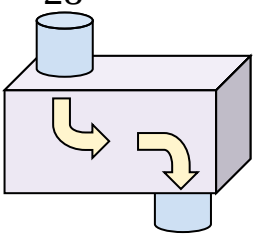

addiere 13

2)

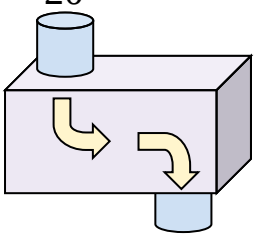

addiere 9

3)

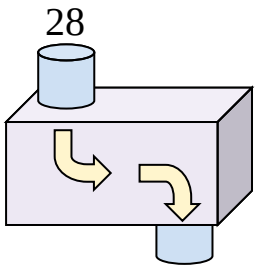

subtrahiere 9

4)

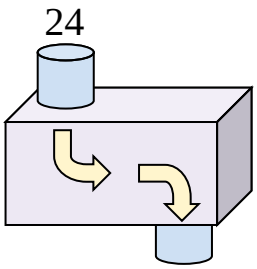

subtrahiere 12

5)

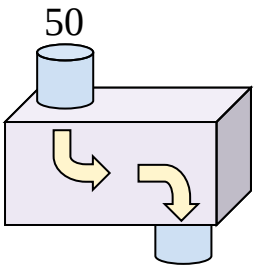

subtrahiere 32

6)

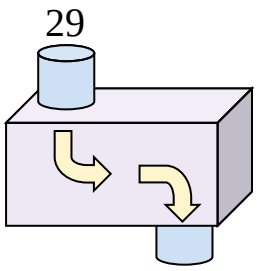

addiere 16

7)

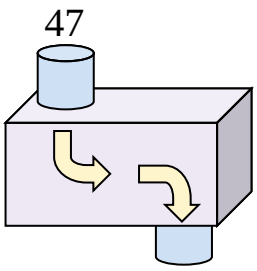

subtrahiere 17

8)

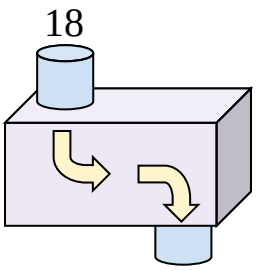

addiere 7

9)

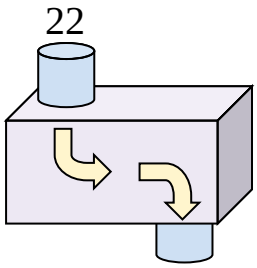

addiere 28

10)

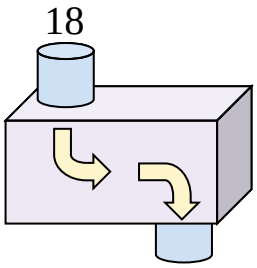

addiere 20

11)

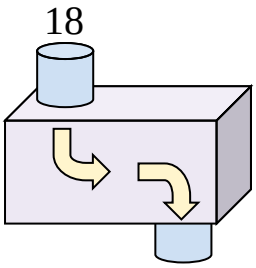

addiere 20

Antworten

Bsp. subtrahiere 16

1. addiere 13
2. addiere 9
3. subtrahiere 9
4. subtrahiere 12
5. subtrahiere 32
6. addiere 16
7. subtrahiere 17
8. addiere 7
9. addiere 28
10. addiere 20
11. addiere 20

1-10	91	82	73	64	55	45	36	27	18	9
11	0									