Umwandeln von Multiplikationsaufgaben

Name:

Schreibe jede Anordnung als eine Multiplikationsaufgabe um und löse sie.

Bsp)



1)

2)

3)



4)

5)

6)

7)

8)

9)

10)



11)



Antworten

Bsp. 10 • 7 = 70

1. _____
2. _____
3. _____
4. _____
5. _____
6. _____
7. _____
8. _____
9. _____
10. _____
11. _____

Umwandeln von Multiplikationsaufgaben Name: **Lösungsschlüssel**

Schreibe jede Anordnung als eine Multiplikationsaufgabe um und löse sie.

Bsp)



1)



2)

3)



4)

5)

6)

7)

8)

9)

10)



11)



Antworten

Bsp. 10 • 7 = 70

1. 10 • 4 = 40
2. 9 • 4 = 36
3. 8 • 3 = 24
4. 2 • 2 = 4
5. 4 • 8 = 32
6. 4 • 2 = 8
7. 4 • 3 = 12
8. 3 • 10 = 30
9. 5 • 3 = 15
10. 7 • 4 = 28
11. 6 • 9 = 54