Umwandeln von Multiplikationsaufgaben

Name:

Schreibe jede Anordnung als eine Multiplikationsaufgabe um und löse sie.

Bsp)



1)



2)

3)



4)

5)

6)



7)



8)

9)

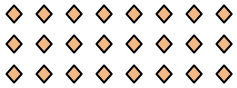

10)

11)



Antworten

Bsp. 10 • 5 = 50

1. _____
2. _____
3. _____
4. _____
5. _____
6. _____
7. _____
8. _____
9. _____
10. _____
11. _____

1-10	91	82	73	64	55	45	36	27	18	9
11	0									

Umwandeln von Multiplikationsaufgaben

Name: **Lösungsschlüssel**

Schreibe jede Anordnung als eine Multiplikationsaufgabe um und löse sie.

Bsp)



1)



2)

3)



4)

5)

6)



7)



8)

9)

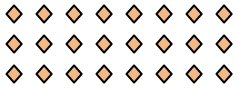

10)

11)



Antworten

Bsp. 10 • 5 = 50

1. 6 • 4 = 24
2. 4 • 8 = 32
3. 9 • 10 = 90
4. 3 • 5 = 15
5. 10 • 4 = 40
6. 8 • 7 = 56
7. 10 • 10 = 100
8. 7 • 2 = 14
9. 3 • 8 = 24
10. 9 • 3 = 27
11. 4 • 4 = 16

1-10	91	82	73	64	55	45	36	27	18	9
11	0									