Multiplizieren mit dem Zahlenstrahl

Name:

Benutze den Zahlenstrahl um jede Aufgabe zu beantworten.

1) 5 • 8 =

8 • 5 =

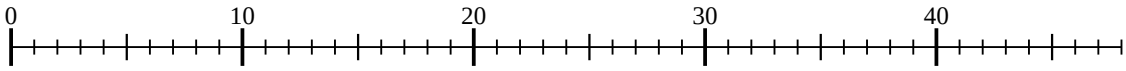

2) 4 • 5 =

5 • 4 =

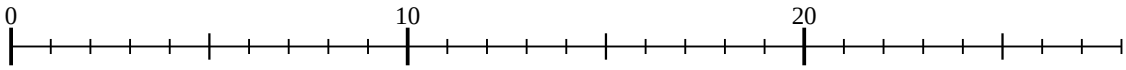

3) 3 • 4 =

4 • 3 =

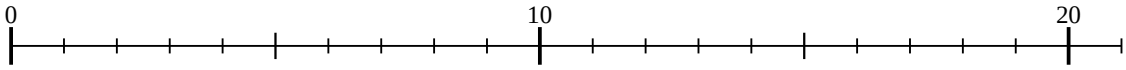

4) 4 • 7 =

7 • 4 =

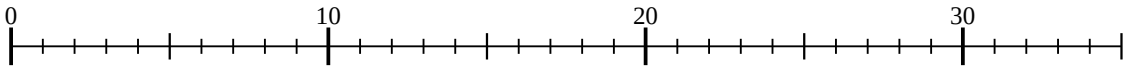

5) 2 • 10 =

10 • 2 =

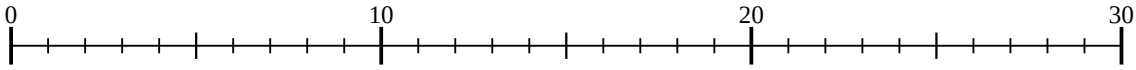

6) 2 • 2 =

2 • 2 =



7) 2 • 8 =

8 • 2 =

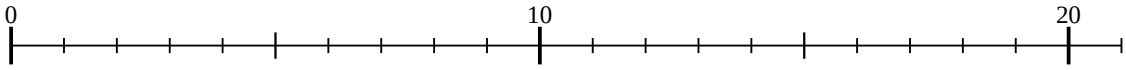

8) 5 • 2 =

2 • 5 =

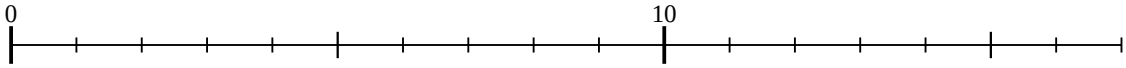

9) 3 • 9 =

9 • 3 =

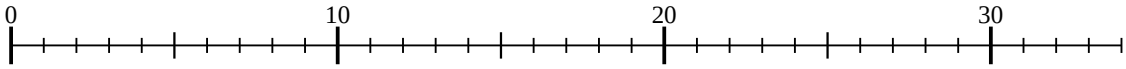

10) 2 • 5 =

5 • 2 =

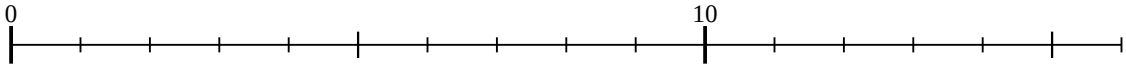

11) 2 • 7 =

7 • 2 =

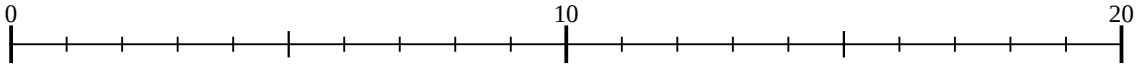

Antworten

1. _____
2. _____
3. _____
4. _____
5. _____
6. _____
7. _____
8. _____
9. _____
10. _____
11. _____

Multiplizieren mit dem Zahlenstrahl

Name: **Lösungsschlüssel**

Benutze den Zahlenstrahl um jede Aufgabe zu beantworten.

1) 5 • 8 =
8 • 5 =

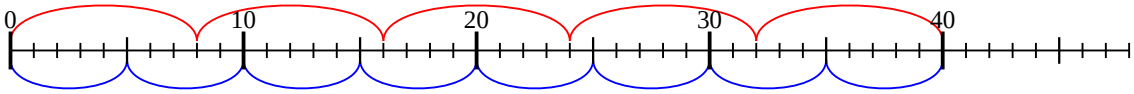

2) 4 • 5 =
5 • 4 =

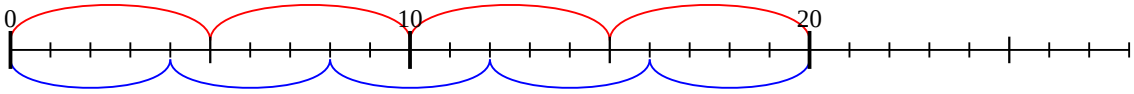

3) 3 • 4 =
4 • 3 =

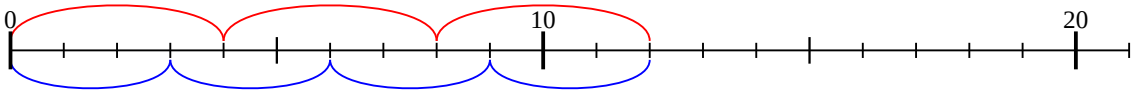

4) 4 • 7 =
7 • 4 =

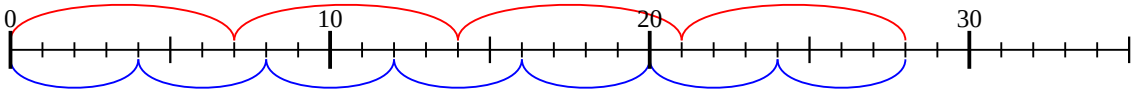

5) 2 • 10 =
10 • 2 =

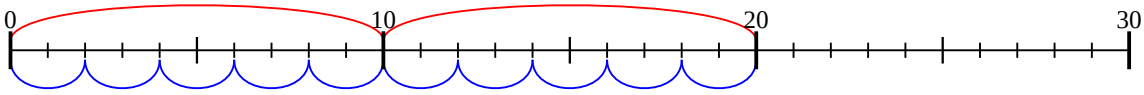

6) 2 • 2 =
2 • 2 =

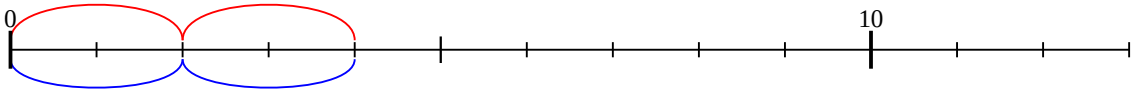

7) 2 • 8 =
8 • 2 =

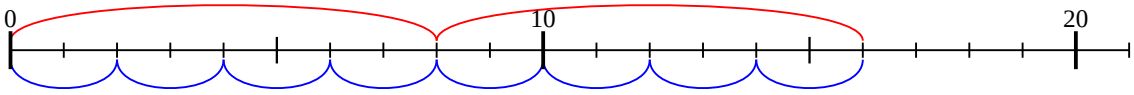

8) 5 • 2 =
2 • 5 =

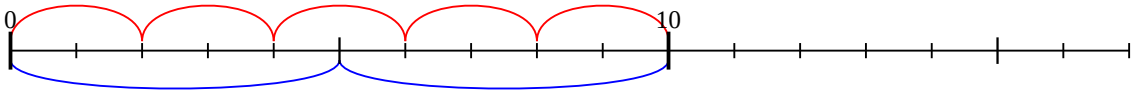

9) 3 • 9 =
9 • 3 =

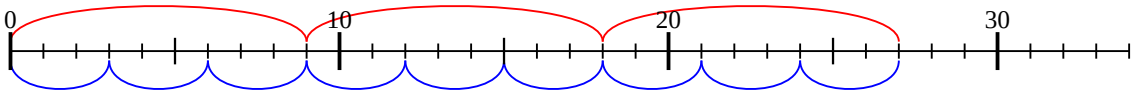

10) 2 • 5 =
5 • 2 =

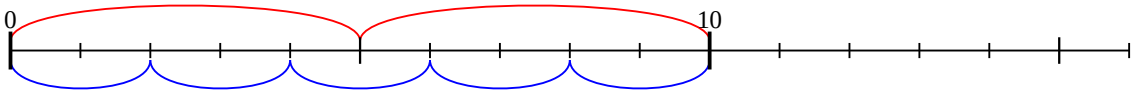

11) 2 • 7 =
7 • 2 =

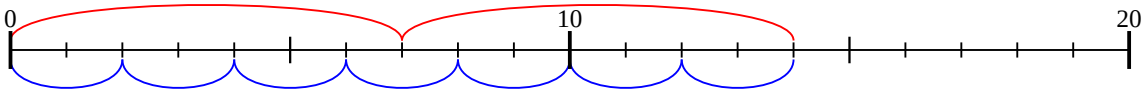

Antworten

1. **40**
2. **20**
3. **12**
4. **28**
5. **20**
6. **4**
7. **16**
8. **10**
9. **27**
10. **10**
11. **14**