Division mit einem Zahlenstrahl

Name:

Benutze den Zahlenstrahl zur Lösung jeder Aufgabe.

1) 35 : 7 =

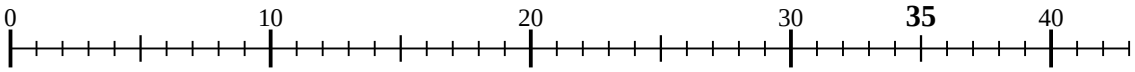

2) 8 : 2 =

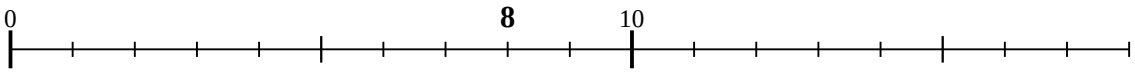

3) 15 : 3 =

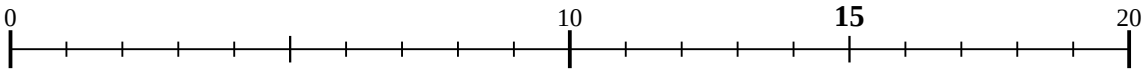

4) 40 : 8 =

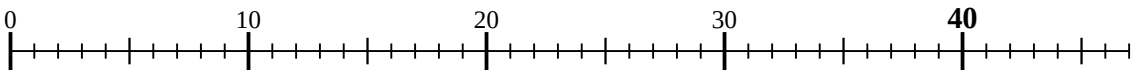

5) 14 : 7 =

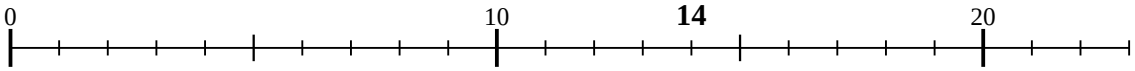

6) 20 : 5 =

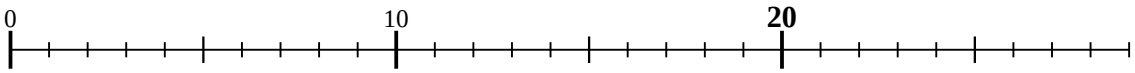

7) 16 : 4 =

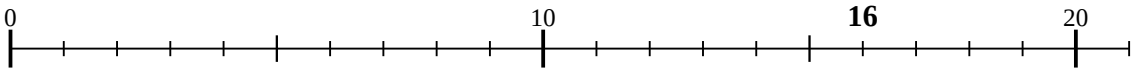

8) 18 : 9 =

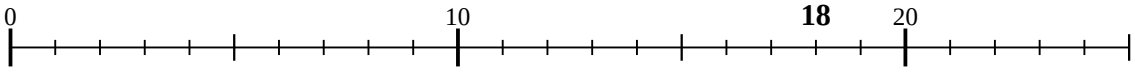

9) 36 : 9 =

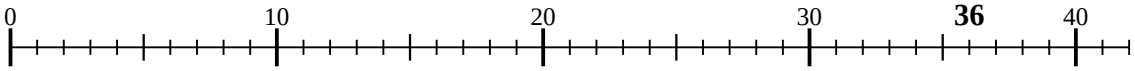

10) 24 : 8 =

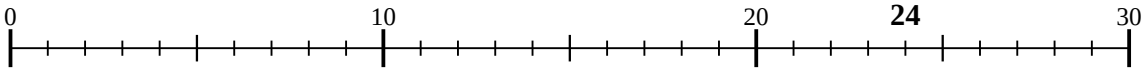

11) 30 : 10 =

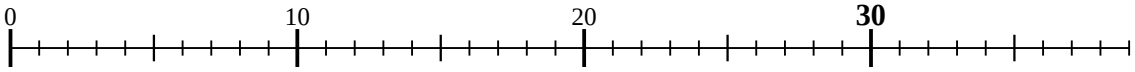

Antworten

1. _____
2. _____
3. _____
4. _____
5. _____
6. _____
7. _____
8. _____
9. _____
10. _____
11. _____

1-10	91	82	73	64	55	45	36	27	18	9
11	0									

Division mit einem Zahlenstrahl

Name: **Lösungsschlüssel**

Benutze den Zahlenstrahl zur Lösung jeder Aufgabe.

1) 35 : 7 =

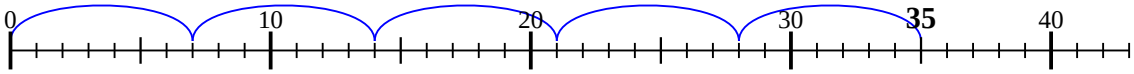

2) 8 : 2 =

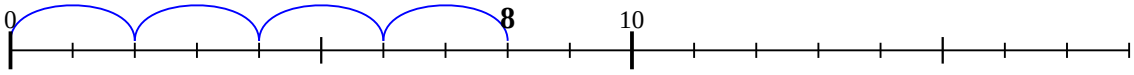

3) 15 : 3 =

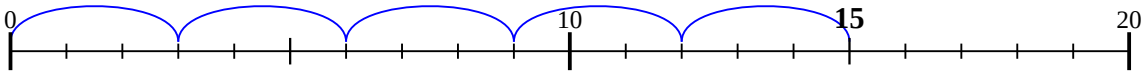

4) 40 : 8 =

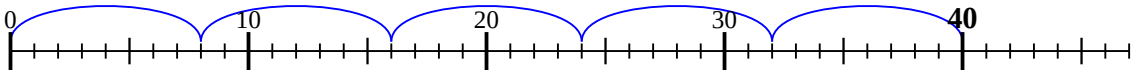

5) 14 : 7 =

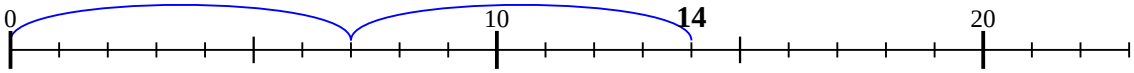

6) 20 : 5 =

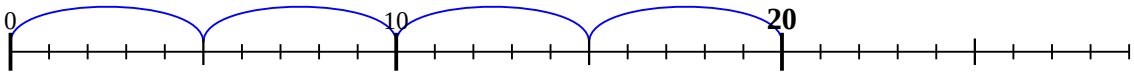

7) 16 : 4 =

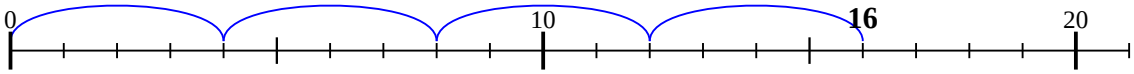

8) 18 : 9 =

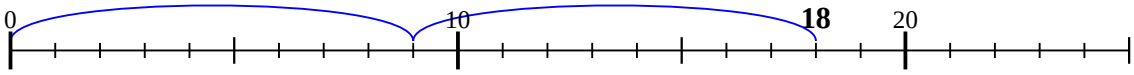

9) 36 : 9 =

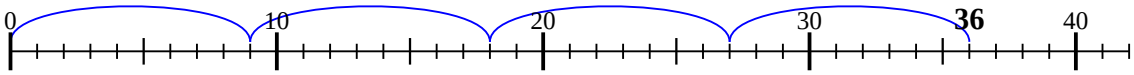

10) 24 : 8 =

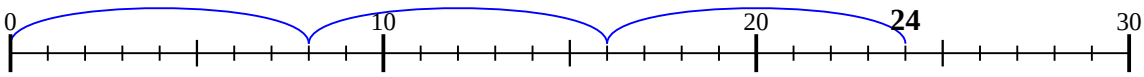

11) 30 : 10 =

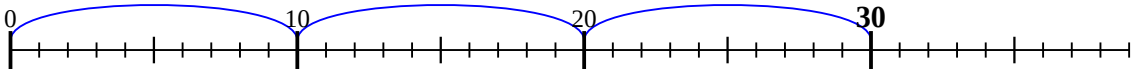

Antworten

1. 5
2. 4
3. 5
4. 5
5. 2
6. 4
7. 4
8. 2
9. 4
10. 3
11. 3

1-10	91	82	73	64	55	45	36	27	18	9
11	0									