Finden von Winkeln in Formen

Name:

Zähle die Anzahl von spitzwinkligen, stumpfwinkligen, rechtwinkligen und überstumpften Winkeln in jeder Form.

Bsp)

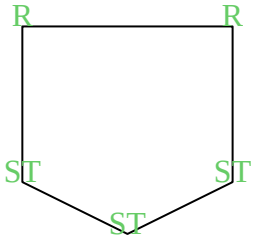

1)

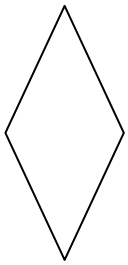

2)

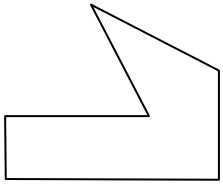

3)

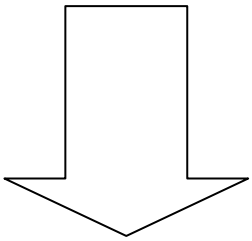

4)

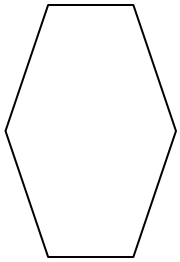

5)

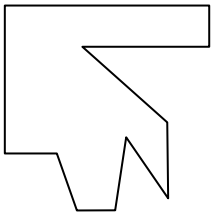

6)



7)

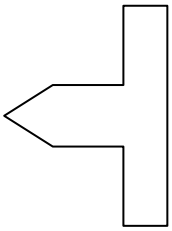

8)

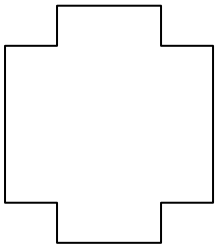

9)

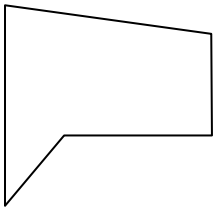

10)

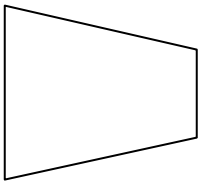

11)

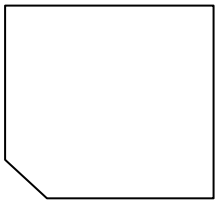

Antworten

	SP	ST	R	Ü
Bsp.	0	3	2	0
1.				
2.				
3.				
4.				
5.				
6.				
7.				
8.				
9.				
10.				
11.				

Finden von Winkeln in Formen

Name: **Lösungsschlüssel**

Zähle die Anzahl von spitzwinkligen, stumpfwinkligen, rechtwinkligen und überstumpften Winkeln in jeder Form.

Bsp)

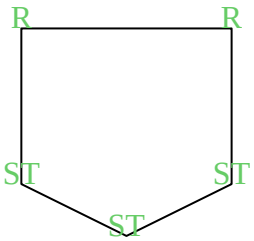

1)

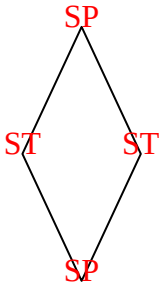

2)

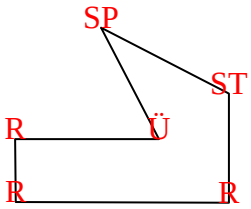

3)

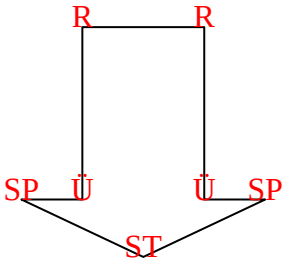

4)

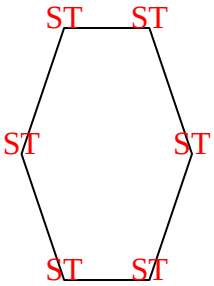

5)

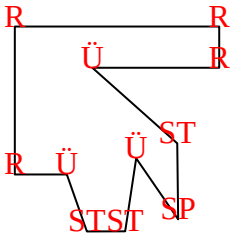

6)

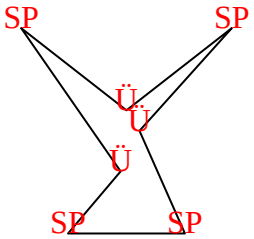

7)

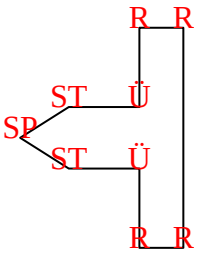

8)

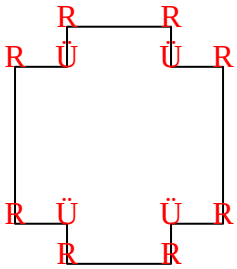

9)

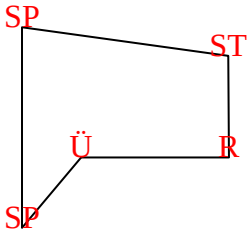

10)

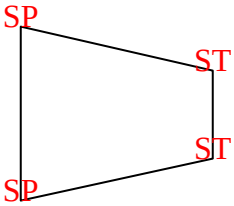

11)

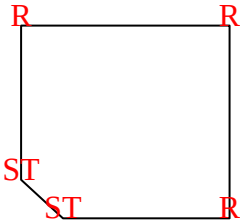

Antworten

	SP	ST	R	Ü
Bsp.	0	3	2	0
1.	2	2	0	0
2.	1	1	3	1
3.	2	1	2	2
4.	0	6	0	0
5.	1	3	4	3
6.	4	0	0	3
7.	1	2	4	2
8.	0	0	8	4
9.	2	1	1	1
10.	2	2	0	0
11.	0	2	3	0