Finden von Winkeln in Formen

Name:

Zähle die Anzahl von spitzwinkligen, stumpfwinkligen, rechtwinkligen und überstumpften Winkeln in jeder Form.

Bsp)

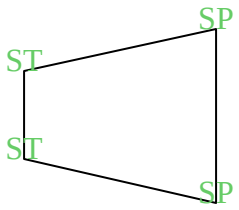

1)



2)

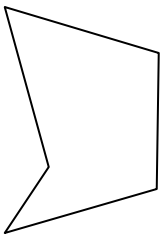

3)



4)

5)

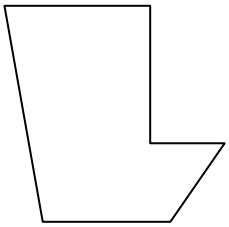

6)

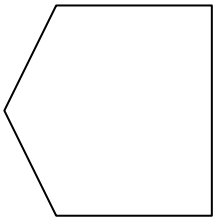

7)

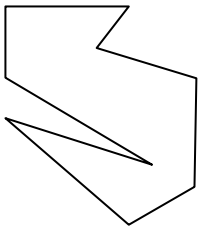

8)

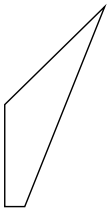

9)

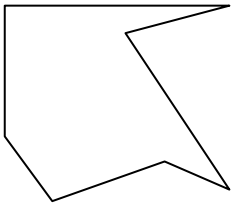

10)

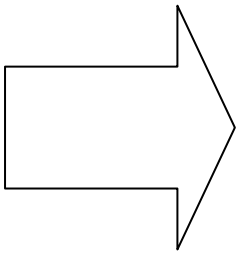

11)



Antworten

	SP	ST	R	Ü
Bsp.	2	2	0	0
1.				
2.				
3.				
4.				
5.				
6.				
7.				
8.				
9.				
10.				
11.				

1-10	91	82	73	64	55	45	36	27	18	9
11	0									

Finden von Winkeln in Formen

Name: **Lösungsschlüssel**

Zähle die Anzahl von spitzwinkligen, stumpfwinkligen, rechtwinkligen und überstumpften Winkeln in jeder Form.

Bsp)

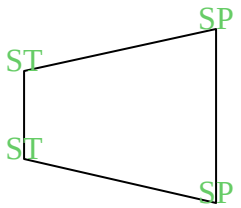

1)

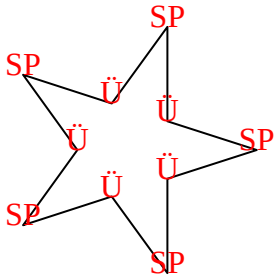

2)

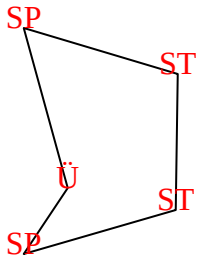

3)

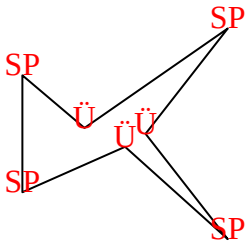

4)



5)

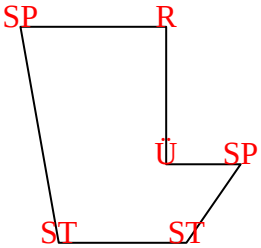

6)

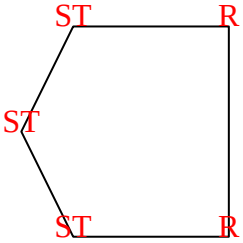

7)

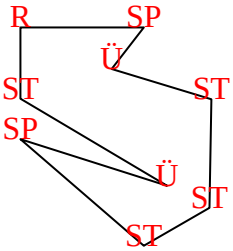

8)

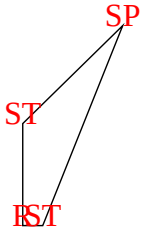

9)

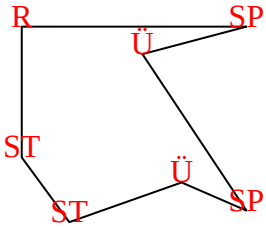

10)

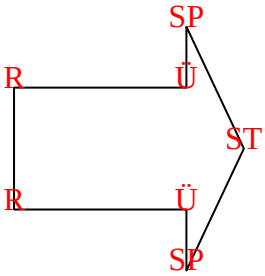

11)

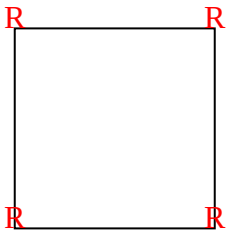

Antworten

	SP	ST	R	Ü
Bsp.	2	2	0	0
1.	5	0	0	5
2.	2	2	0	1
3.	4	0	0	3
4.	0	0	4	0
5.	2	2	1	1
6.	0	3	2	0
7.	2	4	1	2
8.	1	2	1	0
9.	2	2	1	2
10.	2	1	2	2
11.	0	0	4	0

1-10	91	82	73	64	55	45	36	27	18	9
11	0									