Finden von Winkeln in Formen

Name:

Zähle die Anzahl von spitzwinkligen, stumpfwinkligen, rechtwinkligen und überstumpften Winkeln in jeder Form.

Bsp)

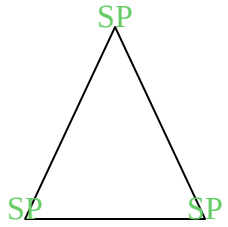

1)

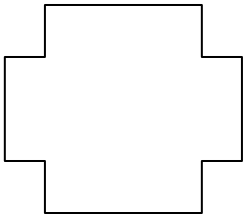

2)

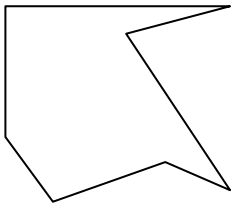

3)

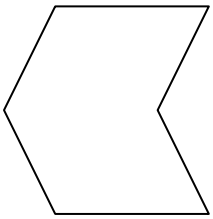

4)

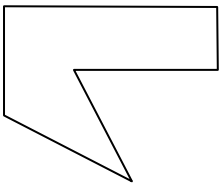

5)

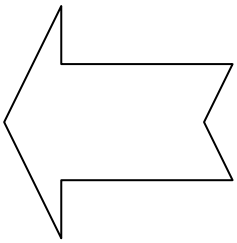

6)

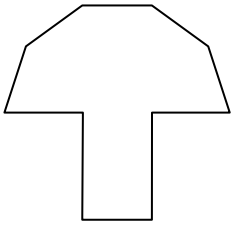

7)

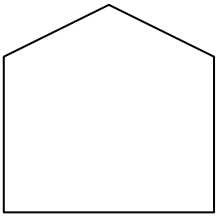

8)



9)



10)

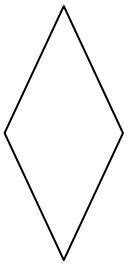

11)

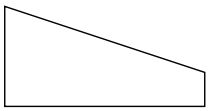

Antworten

	SP	ST	R	Ü
Bsp.	3	0	0	0
1.				
2.				
3.				
4.				
5.				
6.				
7.				
8.				
9.				
10.				
11.				

1-10	91	82	73	64	55	45	36	27	18	9
11	0									

Finden von Winkeln in Formen

Name: **Lösungsschlüssel**

Zähle die Anzahl von spitzwinkligen, stumpfwinkligen, rechtwinkligen und überstumpften Winkeln in jeder Form.

Bsp)

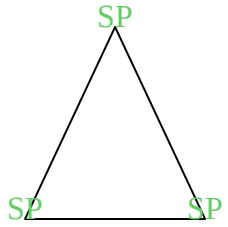

1)

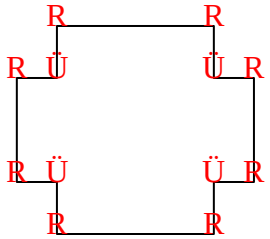

2)

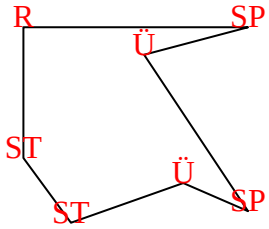

3)

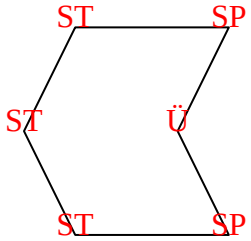

4)

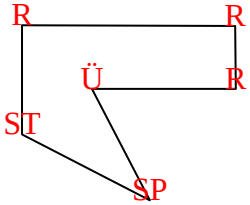

5)

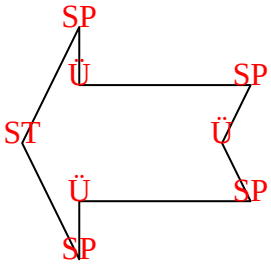

6)

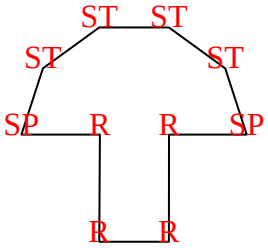

7)

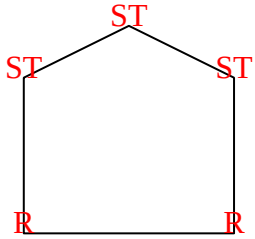

8)

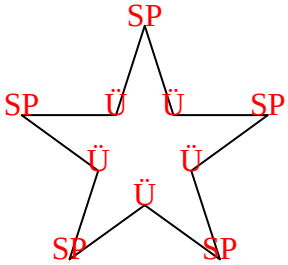

9)

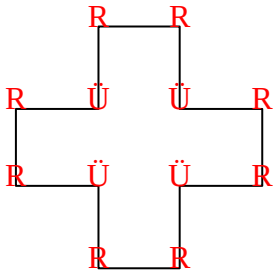

10)

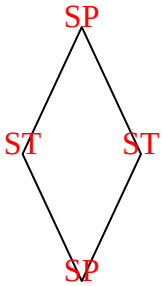

11)

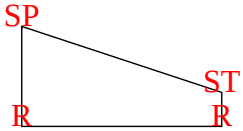

Antworten

	SP	ST	R	Ü
Bsp.	3	0	0	0
1.	0	0	8	4
2.	2	2	1	2
3.	2	3	0	1
4.	1	1	3	1
5.	4	1	0	3
6.	2	4	4	0
7.	0	3	2	0
8.	5	0	0	5
9.	0	0	8	4
10.	2	2	0	0
11.	1	1	2	0

1-10	91	82	73	64	55	45	36	27	18	9
11	0									