Finden von Winkeln in Formen

Name:

Zähle die Anzahl von spitzwinkligen, stumpfwinkligen und rechten Winkeln in jeder Form.

Bsp)

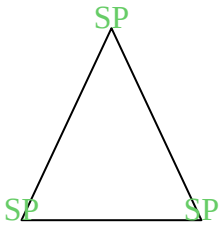

1)



2)

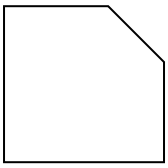

3)

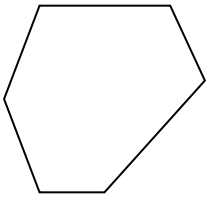

4)

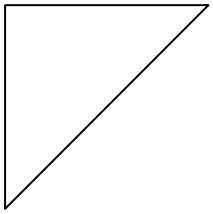

5)

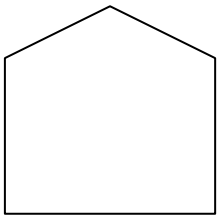

6)

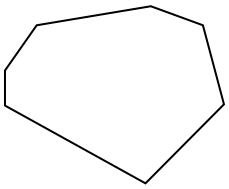

7)

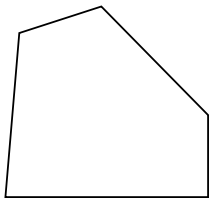

8)

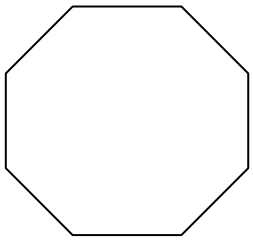

9)

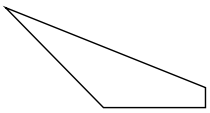

10)

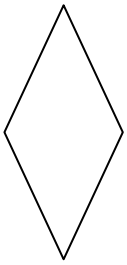

11)

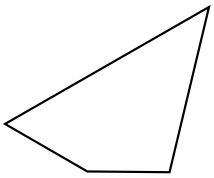

Antworten

	SP	ST	R
Bsp.	3	0	0
1.			
2.			
3.			
4.			
5.			
6.			
7.			
8.			
9.			
10.			
11.			

Finden von Winkeln in Formen

Name: **Lösungsschlüssel**

Zähle die Anzahl von spitzwinkligen, stumpfwinkligen und rechten Winkeln in jeder Form.

Bsp)

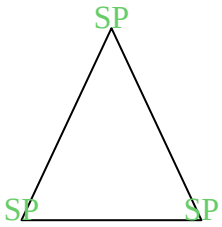

1)

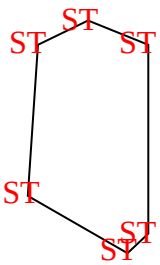

2)

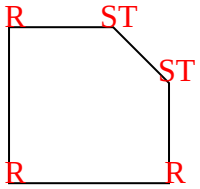

3)

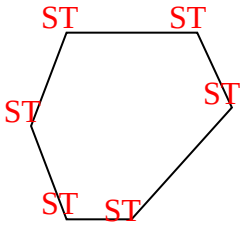

4)

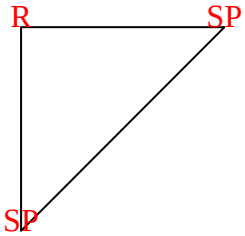

5)

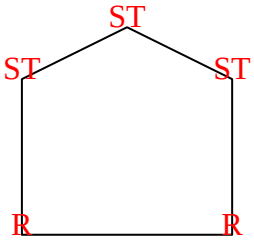

6)

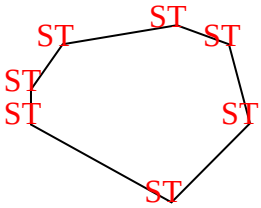

7)

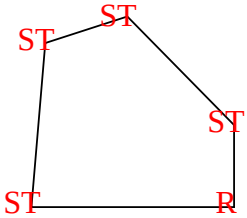

8)

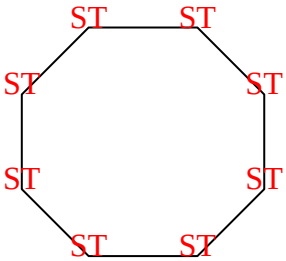

9)

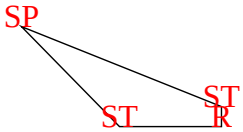

10)

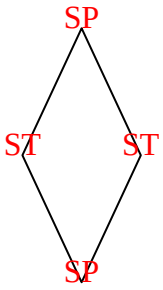

11)

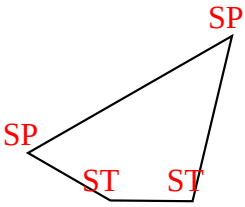

Antworten

	SP	ST	R
Bsp.	3	0	0
1.	0	6	0
2.	0	2	3
3.	0	6	0
4.	2	0	1
5.	0	3	2
6.	0	7	0
7.	0	4	1
8.	0	8	0
9.	1	2	1
10.	2	2	0
11.	2	2	0